How many dots are there in all?

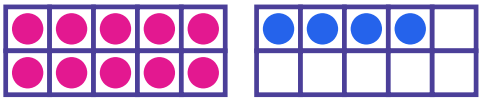

10 and 2 make ___.

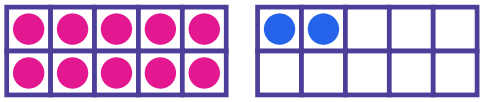

How many dots are there in all?

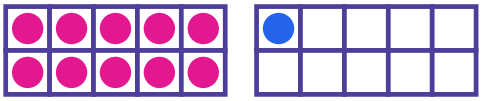

10 and 1 make ___.

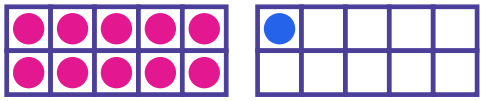

How many dots are there in all?

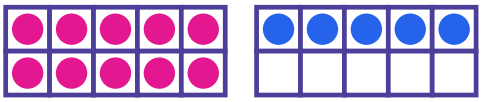

10 and 5 make ___.

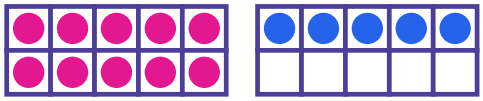

How many dots are there in all?

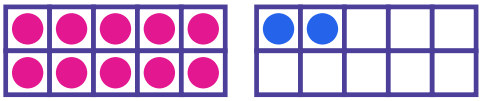

10 and 4 make ___.

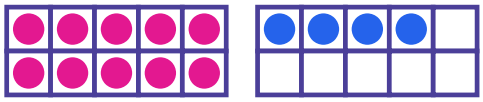

Teen Numbers: Ten and Some More · 2

ANSWER

12

Teen Numbers: Ten and Some More · 1

ANSWER

14

Teen Numbers: Ten and Some More · 4

ANSWER

11

Teen Numbers: Ten and Some More · 3

ANSWER

11

Teen Numbers: Ten and Some More · 6

ANSWER

15

Teen Numbers: Ten and Some More · 5

ANSWER

15

Teen Numbers: Ten and Some More · 8

ANSWER

14

Teen Numbers: Ten and Some More · 7

ANSWER

12

10 and 6 make ___.



10 and 3 make ___.

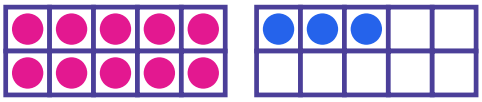

How many dots are there in all?



10 and 7 make ___.



11 is 10 and ___.

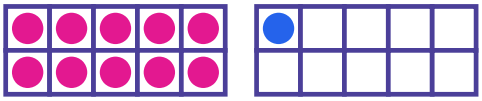

10 + 8 = ___



16 is 10 and ___.



10 + 3 = ___

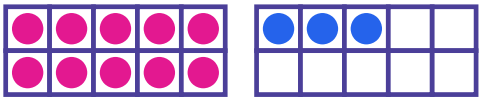

Teen Numbers: Ten and Some More · 10

ANSWER

13

Teen Numbers: Ten and Some More · 9

ANSWER

16

Teen Numbers: Ten and Some More · 12

ANSWER

17

Teen Numbers: Ten and Some More · 11

ANSWER

16

Teen Numbers: Ten and Some More · 14

ANSWER

18

Teen Numbers: Ten and Some More · 13

ANSWER

1

Teen Numbers: Ten and Some More · 16

ANSWER

13

Teen Numbers: Ten and Some More · 15

ANSWER

6

13 is 10 and ___.

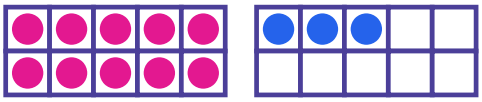

How many dots are there in all?

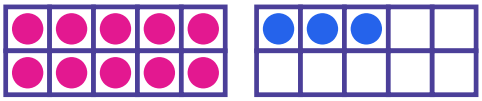

How many dots are there in all?



10 + 1 = ___

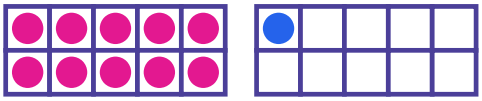

10 and 8 make ___.



17 is 10 and ___.



15 is 10 and ___.

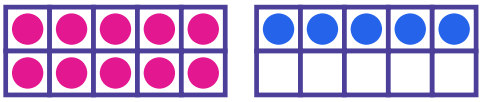

18 is 10 and ___.



Teen Numbers: Ten and Some More · 18

ANSWER

13

Teen Numbers: Ten and Some More · 17

ANSWER

3

Teen Numbers: Ten and Some More · 20

ANSWER

11

Teen Numbers: Ten and Some More · 19

ANSWER

17

Teen Numbers: Ten and Some More · 22

ANSWER

7

Teen Numbers: Ten and Some More · 21

ANSWER

18

Teen Numbers: Ten and Some More · 24

ANSWER

8

Teen Numbers: Ten and Some More · 23

ANSWER

5