**Task card 1** Tally Marks

Kids voted for their favorite fruit. How many votes in all?

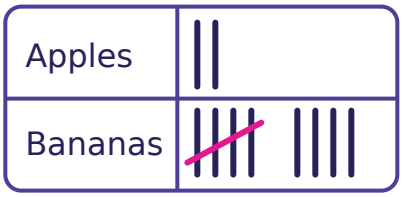


**Task card 2** Tally Marks

Kids voted for their favorite toy. How many votes in all?




**Task card 3** Tally Marks

Kids voted for their favorite toy. Which got more votes: balls or blocks?




**Task card 4** Tally Marks

Kids voted for their favorite pet. How many votes in all?

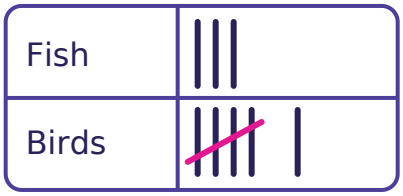


**Task card 5** Tally Marks

Kids voted for their favorite snack. How many votes for grapes?

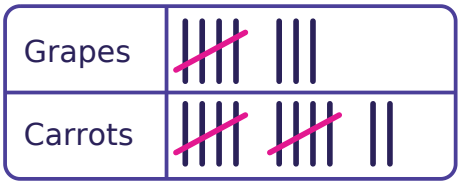


**Task card 6** Tally Marks

Kids voted for their favorite fruit. How many votes for bananas?



**Task card 7** Tally Marks

Kids voted for their favorite snack. Which got more votes: grapes or carrots?

| | |
|---|---|
| Grapes | 19 |
| Carrots | 13 |

**Task card 8** Tally Marks

Kids voted for their favorite snack. Which got more votes: grapes or carrots?

| | |
|---|---|
| Grapes | 3 |
| Carrots | 4 |

**Task card 9** Tally Marks

How many tally marks?



**Task card 10** Tally Marks

Kids voted for their favorite fruit. How many votes in all?

| | |
|---|---|
| Apples | 6 |
| Bananas | 9 |

**Task card 11** Tally Marks

Kids voted for their favorite snack. How many more votes for carrots than for grapes?

| | |
|---|---|
| Grapes | 6 |
| Carrots | 12 |

**Task card 12** Tally Marks

Kids voted for their favorite fruit. How many more votes for apples than for bananas?

| | |
|---|---|
| Apples | 19 |
| Bananas | 13 |

**Task card 13** Tally Marks

How many tally marks?



**Task card 14** Tally Marks

Kids voted for their favorite snack. How many more votes for grapes than for carrots?

| | |
|---|---|
| Grapes |  |
| Carrots |  |

**Task card 15** Tally Marks

How many tally marks?



**Task card 16** Tally Marks

Kids voted for their favorite fruit. How many votes for bananas?

| | |
|---|---|
| Apples |  |
| Bananas |  |

**Task card 17** Tally Marks

Kids voted for their favorite color. How many votes for red?

| | |
|---|---|
| Red |  |
| Blue |  |

**Task card 18** Tally Marks

How many tally marks?



**Task card 19** Tally Marks

Kids voted for their favorite fruit. Which got more votes: apples or bananas?

| | |
|---|---|
| Apples | 𝍸 |
| Bananas | 𝍸 𝍸 \|\| |

**Task card 20** Tally Marks

Kids voted for their favorite pet. How many votes for cats?

| | |
|---|---|
| Cats | 𝍸 \|\|\| |
| Dogs | \|\| |

**Task card 21** Tally Marks

Kids voted for their favorite toy. How many votes for balls?

| | |
|---|---|
| Balls | 𝍸 𝍸 \|\|\|\| |
| Blocks | 𝍸 𝍸 |

**Task card 22** Tally Marks

How many tally marks?

\|\|\|

**Task card 23** Tally Marks

Kids voted for their favorite snack. How many more votes for carrots than for grapes?

| | |
|---|---|
| Grapes | 𝍸 \|\|\| |
| Carrots | 𝍸 𝍸 𝍸 \| |

**Task card 24** Tally Marks

Kids voted for their favorite fruit. How many votes for bananas?

| | |
|---|---|
| Apples | \|\| |
| Bananas | 𝍸 𝍸 𝍸 𝍸 |

# Tally Marks Task Cards

Recording sheet · Preschool · Count the tally marks. Count each bundle of five as 5.

Name: _____ Date: _____

Scan to check your answers

| | | | |
|---|---|---|---|
| 1 | 2 | 3 | 4 |
| 5 | 6 | 7 | 8 |
| 9 | 10 | 11 | 12 |
| 13 | 14 | 15 | 16 |
| 17 | 18 | 19 | 20 |
| 21 | 22 | 23 | 24 |

# Tally Marks Task Cards: Answer Key

Preschool · Hard

The answers online

| | | |
|---|---|---|
| **1.** 11 | **2.** 8 | **3.** blocks |
| **4.** 9 | **5.** 8 | **6.** 15 |
| **7.** grapes | **8.** carrots | **9.** 15 |
| **10.** 17 | **11.** 8 | **12.** 6 |
| **13.** 11 | **14.** 5 | **15.** 6 |
| **16.** 13 | **17.** 15 | **18.** 10 |
| **19.** bananas | **20.** 8 | **21.** 14 |
| **22.** 3 | **23.** 8 | **24.** 20 |