Task card 1 Tally Marks

Kids voted for their favorite pet. How many votes for birds?

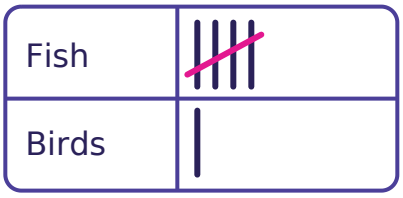

Task card 2 Tally Marks

Kids voted for their favorite pet. Which got more votes: fish or birds?

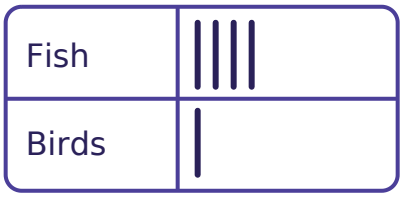

Task card 3 Tally Marks

Kids voted for their favorite color. How many votes for red?

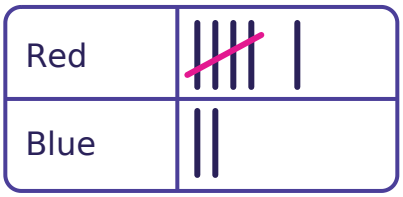

Task card 4 Tally Marks

Kids voted for their favorite pet. How many votes for cats?

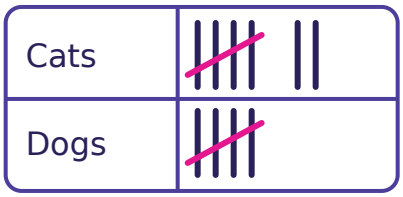

Task card 5 Tally Marks

How many tally marks?



Task card 6 Tally Marks

Kids voted for their favorite pet. Which got more votes: fish or birds?

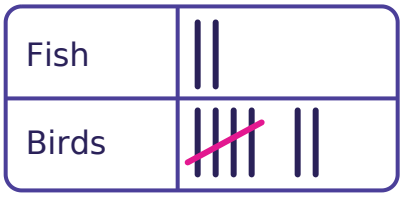

Task card 7 Tally Marks

How many tally marks?



Task card 8 Tally Marks

How many tally marks?



Task card 9 Tally Marks

Kids voted for their favorite fruit. How many votes for bananas?

Apples	
Bananas	

Task card 10 Tally Marks

Kids voted for their favorite toy. Which got more votes: balls or blocks?

Balls	
Blocks	

Task card 11 Tally Marks

How many tally marks?



Task card 12 Tally Marks

Kids voted for their favorite pet. How many votes for fish?

Fish	
Birds	

Task card 13 Tally Marks

Kids voted for their favorite toy. Which got more votes: balls or blocks?

Balls	7
Blocks	9

Task card 14 Tally Marks

How many tally marks?

6

Task card 15 Tally Marks

Kids voted for their favorite toy. How many votes for blocks?

Balls	8
Blocks	7

Task card 16 Tally Marks

Kids voted for their favorite pet. Which got more votes: cats or dogs?

Cats	5
Dogs	6

Task card 17 Tally Marks

Kids voted for their favorite color. How many more votes for blue than for red?

Red	4
Blue	6

Task card 18 Tally Marks

Kids voted for their favorite fruit. How many votes in all?

Apples	2
Bananas	3

Task card 19 Tally Marks

Kids voted for their favorite pet. How many votes in all?

Fish	𝍸
Birds	𝍸 𝍸 𝍸

Task card 20 Tally Marks

Kids voted for their favorite toy. How many votes in all?

Balls	𝍸 𝍸
Blocks	𝍸 𝍸

Task card 21 Tally Marks

Kids voted for their favorite color. How many votes for blue?

Red	𝍸 𝍸 𝍸
Blue	𝍸 𝍸

Task card 22 Tally Marks

Kids voted for their favorite toy. How many more votes for balls than for blocks?

Balls	𝍸 𝍸
Blocks	𝍸 𝍸

Task card 23 Tally Marks

Kids voted for their favorite fruit. Which got more votes: apples or bananas?

Apples	𝍸
Bananas	𝍸

Task card 24 Tally Marks

Kids voted for their favorite pet. Which got more votes: cats or dogs?

Cats	𝍸 𝍸
Dogs	𝍸 𝍸

Tally Marks Task Cards

Recording sheet · Preschool · Count the tally marks. Count each bundle of five as 5.

Name: _____ Date: _____

Scan to check your answers

1	2	3	4
5	6	7	8
9	10	11	12
13	14	15	16
17	18	19	20
21	22	23	24

Tally Marks Task Cards: Answer Key

Preschool · Medium

The answers online

1. 1	**2.** fish	**3.** 6
4. 7	**5.** 4	**6.** birds
7. 7	**8.** 8	**9.** 9
10. balls	**11.** 11	**12.** 11
13. blocks	**14.** 6	**15.** 12
16. dogs	**17.** 2	**18.** 5
19. 15	**20.** 15	**21.** 7
22. 5	**23.** apples	**24.** dogs