Task card 1 Tally Marks

Kids voted for their favorite fruit. How many votes in all?

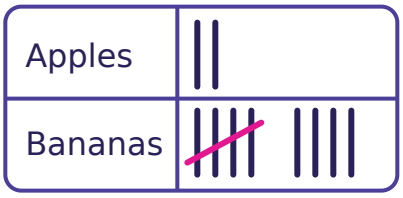

Task card 2 Tally Marks

Kids voted for their favorite toy. How many votes in all?



Task card 3 Tally Marks

Kids voted for their favorite toy. Which got more votes: balls or blocks?



Task card 4 Tally Marks

Kids voted for their favorite pet. How many votes in all?

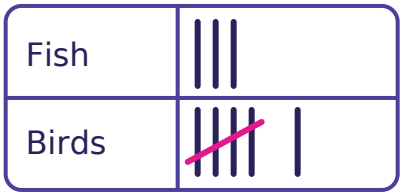

Task card 5 Tally Marks

Kids voted for their favorite snack. How many votes for grapes?

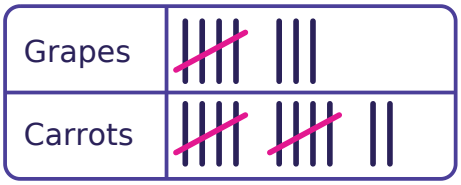

Task card 6 Tally Marks

Kids voted for their favorite fruit. How many votes for bananas?



Task card 7 Tally Marks

Kids voted for their favorite snack. Which got more votes: grapes or carrots?

Grapes	
Carrots	

Task card 8 Tally Marks

Kids voted for their favorite snack. Which got more votes: grapes or carrots?

Grapes	
Carrots	

Task card 9 Tally Marks

How many tally marks?



Task card 10 Tally Marks

Kids voted for their favorite fruit. How many votes in all?

Apples	
Bananas	

Task card 11 Tally Marks

Kids voted for their favorite snack. How many more votes for carrots than for grapes?

Grapes	
Carrots	

Task card 12 Tally Marks

Kids voted for their favorite fruit. How many more votes for apples than for bananas?

Apples	
Bananas	

Task card 13 Tally Marks

How many tally marks?



Task card 14 Tally Marks

Kids voted for their favorite snack. How many more votes for grapes than for carrots?

Grapes	
Carrots	

Task card 15 Tally Marks

How many tally marks?



Task card 16 Tally Marks

Kids voted for their favorite fruit. How many votes for bananas?

Apples	
Bananas	

Task card 17 Tally Marks

Kids voted for their favorite color. How many votes for red?

Red	
Blue	

Task card 18 Tally Marks

How many tally marks?



Task card 19 Tally Marks

Kids voted for their favorite fruit. Which got more votes: apples or bananas?

Apples	𝍸
Bananas	𝍸 𝍸 ||

Task card 20 Tally Marks

Kids voted for their favorite pet. How many votes for cats?

Cats	𝍸 |||
Dogs	||

Task card 21 Tally Marks

Kids voted for their favorite toy. How many votes for balls?

Balls	𝍸 𝍸 ||||
Blocks	𝍸 𝍸

Task card 22 Tally Marks

How many tally marks?

\|\|\|

Task card 23 Tally Marks

Kids voted for their favorite snack. How many more votes for carrots than for grapes?

Grapes	𝍸 |||
Carrots	𝍸 𝍸 𝍸 |

Task card 24 Tally Marks

Kids voted for their favorite fruit. How many votes for bananas?

Apples	||
Bananas	𝍸 𝍸 𝍸 𝍸

Tally Marks Task Cards

Recording sheet · Preschool · Count the tally marks. Count each bundle of five as 5.

Name: _____ Date: _____

Scan to check your answers

1	2	3	4
5	6	7	8
9	10	11	12
13	14	15	16
17	18	19	20
21	22	23	24

Tally Marks Task Cards: Answer Key

Preschool · Hard

The answers online

1. 11	**2.** 8	**3.** blocks
4. 9	**5.** 8	**6.** 15
7. grapes	**8.** carrots	**9.** 15
10. 17	**11.** 8	**12.** 6
13. 11	**14.** 5	**15.** 6
16. 13	**17.** 15	**18.** 10
19. bananas	**20.** 8	**21.** 14
22. 3	**23.** 8	**24.** 20