Tally Marks · 1

Kids voted for their favorite fruit. How many votes in all?

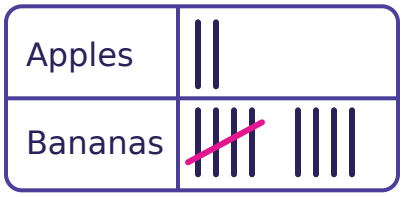

Tally Marks · 2

Kids voted for their favorite toy. How many votes in all?



Tally Marks · 3

Kids voted for their favorite toy. Which got more votes: balls or blocks?



Tally Marks · 4

Kids voted for their favorite pet. How many votes in all?

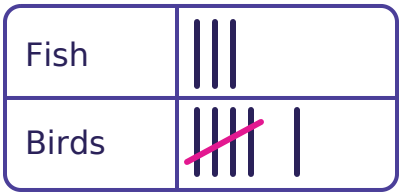

Tally Marks · 5

Kids voted for their favorite snack. How many votes for grapes?

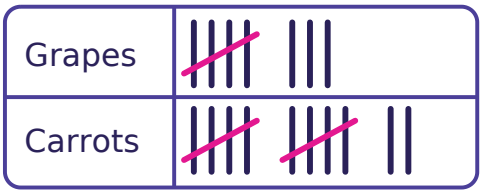

Tally Marks · 6

Kids voted for their favorite fruit. How many votes for bananas?



Tally Marks · 7

Kids voted for their favorite snack. Which got more votes: grapes or carrots?



Tally Marks · 8

Kids voted for their favorite snack. Which got more votes: grapes or carrots?



Tally Marks · 2

ANSWER

8

Tally Marks · 1

ANSWER

11

Tally Marks · 4

ANSWER

9

Tally Marks · 3

ANSWER

blocks

Tally Marks · 6

ANSWER

15

Tally Marks · 5

ANSWER

8

Tally Marks · 8

ANSWER

carrots

Tally Marks · 7

ANSWER

grapes

Tally Marks · 9

How many tally marks?



Tally Marks · 10

Kids voted for their favorite fruit. How many votes in all?

Apples	
Bananas	

Tally Marks · 11

Kids voted for their favorite snack. How many more votes for carrots than for grapes?

Grapes	
Carrots	

Tally Marks · 12

Kids voted for their favorite fruit. How many more votes for apples than for bananas?

Apples	
Bananas	

Tally Marks · 13

How many tally marks?



Tally Marks · 14

Kids voted for their favorite snack. How many more votes for grapes than for carrots?

Grapes	
Carrots	

Tally Marks · 15

How many tally marks?



Tally Marks · 16

Kids voted for their favorite fruit. How many votes for bananas?

Apples	
Bananas	

Tally Marks · 10

ANSWER

17

Tally Marks · 9

ANSWER

15

Tally Marks · 12

ANSWER

6

Tally Marks · 11

ANSWER

8

Tally Marks · 14

ANSWER

5

Tally Marks · 13

ANSWER

11

Tally Marks · 16

ANSWER

13

Tally Marks · 15

ANSWER

6

Tally Marks · 17

Kids voted for their favorite color. How many votes for red?

Red	
Blue	

Tally Marks · 18

How many tally marks?



Tally Marks · 19

Kids voted for their favorite fruit. Which got more votes: apples or bananas?

Apples	
Bananas	

Tally Marks · 20

Kids voted for their favorite pet. How many votes for cats?

Cats	
Dogs	

Tally Marks · 21

Kids voted for their favorite toy. How many votes for balls?

Balls	
Blocks	

Tally Marks · 22

How many tally marks?



Tally Marks · 23

Kids voted for their favorite snack. How many more votes for carrots than for grapes?

Grapes	
Carrots	

Tally Marks · 24

Kids voted for their favorite fruit. How many votes for bananas?

Apples	
Bananas	

Tally Marks · 18

ANSWER

10

Tally Marks · 17

ANSWER

15

Tally Marks · 20

ANSWER

8

Tally Marks · 19

ANSWER

bananas

Tally Marks · 22

ANSWER

3

Tally Marks · 21

ANSWER

14

Tally Marks · 24

ANSWER

20

Tally Marks · 23

ANSWER

8