Tally Marks · 1

Kids voted for their favorite pet. How many votes for birds?

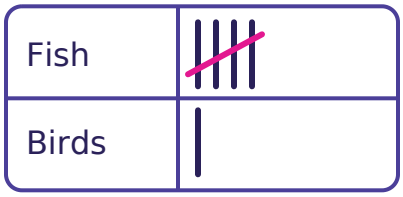

Tally Marks · 2

Kids voted for their favorite pet. Which got more votes: fish or birds?

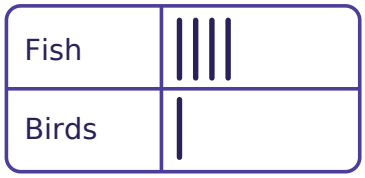

Tally Marks · 3

Kids voted for their favorite color. How many votes for red?

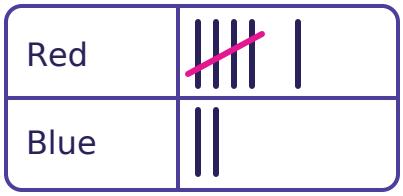

Tally Marks · 4

Kids voted for their favorite pet. How many votes for cats?

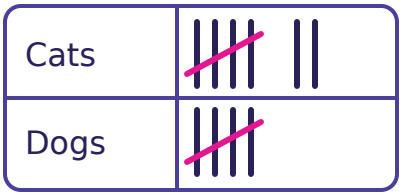

Tally Marks · 5

How many tally marks?



Tally Marks · 6

Kids voted for their favorite pet. Which got more votes: fish or birds?

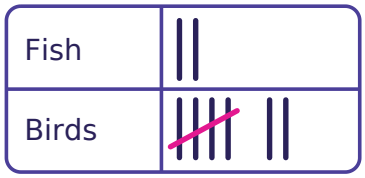

Tally Marks · 7

How many tally marks?



Tally Marks · 8

How many tally marks?



Tally Marks · 2

ANSWER

fish

Tally Marks · 1

ANSWER

1

Tally Marks · 4

ANSWER

7

Tally Marks · 3

ANSWER

6

Tally Marks · 6

ANSWER

birds

Tally Marks · 5

ANSWER

4

Tally Marks · 8

ANSWER

8

Tally Marks · 7

ANSWER

7

Tally Marks · 9

Kids voted for their favorite fruit. How many votes for bananas?

Apples	
Bananas	

Tally Marks · 10

Kids voted for their favorite toy. Which got more votes: balls or blocks?

Balls	
Blocks	

Tally Marks · 11

How many tally marks?



Tally Marks · 12

Kids voted for their favorite pet. How many votes for fish?

Fish	
Birds	

Tally Marks · 13

Kids voted for their favorite toy. Which got more votes: balls or blocks?

Balls	
Blocks	

Tally Marks · 14

How many tally marks?



Tally Marks · 15

Kids voted for their favorite toy. How many votes for blocks?

Balls	
Blocks	

Tally Marks · 16

Kids voted for their favorite pet. Which got more votes: cats or dogs?

Cats	
Dogs	

Tally Marks · 10

ANSWER

balls

Tally Marks · 9

ANSWER

9

Tally Marks · 12

ANSWER

11

Tally Marks · 11

ANSWER

11

Tally Marks · 14

ANSWER

6

Tally Marks · 13

ANSWER

blocks

Tally Marks · 16

ANSWER

dogs

Tally Marks · 15

ANSWER

12

Tally Marks · 17

Kids voted for their favorite color. How many more votes for blue than for red?

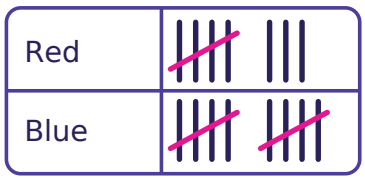

Tally Marks · 18

Kids voted for their favorite fruit. How many votes in all?



Tally Marks · 19

Kids voted for their favorite pet. How many votes in all?

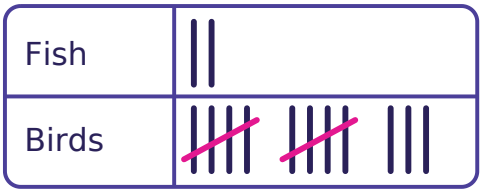

Tally Marks · 20

Kids voted for their favorite toy. How many votes in all?



Tally Marks · 21

Kids voted for their favorite color. How many votes for blue?

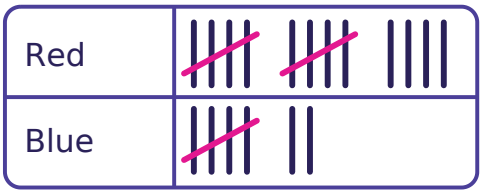

Tally Marks · 22

Kids voted for their favorite toy. How many more votes for balls than for blocks?



Tally Marks · 23

Kids voted for their favorite fruit. Which got more votes: apples or bananas?



Tally Marks · 24

Kids voted for their favorite pet. Which got more votes: cats or dogs?

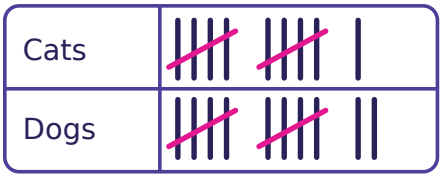

Tally Marks · 18

ANSWER

5

Tally Marks · 17

ANSWER

2

Tally Marks · 20

ANSWER

15

Tally Marks · 19

ANSWER

15

Tally Marks · 22

ANSWER

5

Tally Marks · 21

ANSWER

7

Tally Marks · 24

ANSWER

dogs

Tally Marks · 23

ANSWER

apples