Tally Marks · 1

Kids voted for their favorite fruit. How many votes in all?

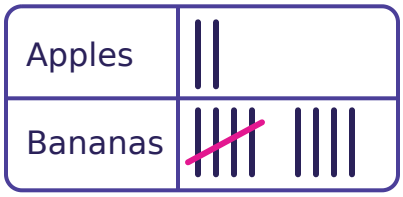


Tally Marks · 2

Kids voted for their favorite toy. How many votes in all?




Tally Marks · 3

Kids voted for their favorite toy. Which got more votes: balls or blocks?




Tally Marks · 4

Kids voted for their favorite pet. How many votes in all?

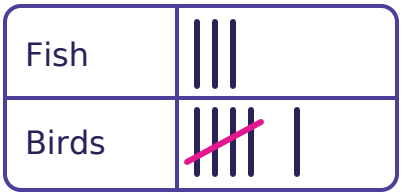


Tally Marks · 5

Kids voted for their favorite snack. How many votes for grapes?

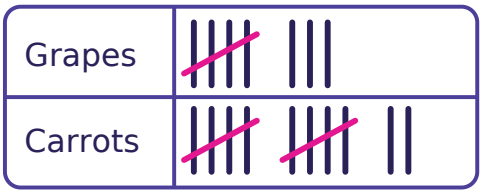


Tally Marks · 6

Kids voted for their favorite fruit. How many votes for bananas?




Tally Marks · 7

Kids voted for their favorite snack. Which got more votes: grapes or carrots?




Tally Marks · 8

Kids voted for their favorite snack. Which got more votes: grapes or carrots?



Tally Marks · 2

**ANSWER**

**8**

Tally Marks · 1

**ANSWER**

**11**

Tally Marks · 4

**ANSWER**

**9**

Tally Marks · 3

**ANSWER**

**blocks**

Tally Marks · 6

**ANSWER**

**15**

Tally Marks · 5

**ANSWER**

**8**

Tally Marks · 8

**ANSWER**

**carrots**

Tally Marks · 7

**ANSWER**

**grapes**

Tally Marks · 9

# How many tally marks?



Tally Marks · 10

Kids voted for their favorite fruit. How many votes in all?

| | |
|---|---|
| Apples |  |
| Bananas |  |

Tally Marks · 11

Kids voted for their favorite snack. How many more votes for carrots than for grapes?

| | |
|---|---|
| Grapes |  |
| Carrots |  |

Tally Marks · 12

Kids voted for their favorite fruit. How many more votes for apples than for bananas?

| | |
|---|---|
| Apples |  |
| Bananas |  |

Tally Marks · 13

# How many tally marks?



Tally Marks · 14

Kids voted for their favorite snack. How many more votes for grapes than for carrots?

| | |
|---|---|
| Grapes |  |
| Carrots |  |

Tally Marks · 15

# How many tally marks?



Tally Marks · 16

Kids voted for their favorite fruit. How many votes for bananas?

| | |
|---|---|
| Apples |  |
| Bananas |  |

Tally Marks · 10

**ANSWER**

# 17

Tally Marks · 9

**ANSWER**

# 15

Tally Marks · 12

**ANSWER**

# 6

Tally Marks · 11

**ANSWER**

# 8

Tally Marks · 14

**ANSWER**

# 5

Tally Marks · 13

**ANSWER**

# 11

Tally Marks · 16

**ANSWER**

# 13

Tally Marks · 15

**ANSWER**

# 6

Tally Marks · 17

Kids voted for their favorite color. How many votes for red?

| | |
|---|---|
| Red |  |
| Blue |  |

Tally Marks · 18

How many tally marks?



Tally Marks · 19

Kids voted for their favorite fruit. Which got more votes: apples or bananas?

| | |
|---|---|
| Apples |  |
| Bananas |  |

Tally Marks · 20

Kids voted for their favorite pet. How many votes for cats?

| | |
|---|---|
| Cats |  |
| Dogs |  |

Tally Marks · 21

Kids voted for their favorite toy. How many votes for balls?

| | |
|---|---|
| Balls |  |
| Blocks |  |

Tally Marks · 22

How many tally marks?



Tally Marks · 23

Kids voted for their favorite snack. How many more votes for carrots than for grapes?

| | |
|---|---|
| Grapes |  |
| Carrots |  |

Tally Marks · 24

Kids voted for their favorite fruit. How many votes for bananas?

| | |
|---|---|
| Apples |  |
| Bananas |  |

Tally Marks · 18

**ANSWER**

**10**

Tally Marks · 17

**ANSWER**

**15**

Tally Marks · 20

**ANSWER**

**8**

Tally Marks · 19

**ANSWER**

**bananas**

Tally Marks · 22

**ANSWER**

**3**

Tally Marks · 21

**ANSWER**

**14**

Tally Marks · 24

**ANSWER**

**20**

Tally Marks · 23

**ANSWER**

**8**