Task card 1 Matching Sides (Symmetry)

Does the right side match the left side like a mirror? Write yes or no.

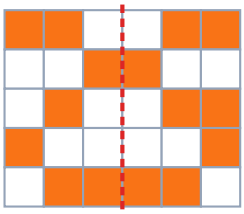

Task card 2 Matching Sides (Symmetry)

Does the dashed line cut this shape into two sides that match? Write yes or no.



Task card 3 Matching Sides (Symmetry)

Does the right side match the left side like a mirror? Write yes or no.

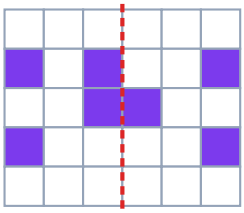

Task card 4 Matching Sides (Symmetry)

Does the dashed line cut this shape into two sides that match? Write yes or no.



Task card 5 Matching Sides (Symmetry)

Does the right side match the left side like a mirror? Write yes or no.

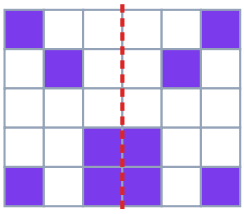

Task card 6 Matching Sides (Symmetry)

Does the dashed line cut this shape into two sides that match? Write yes or no.

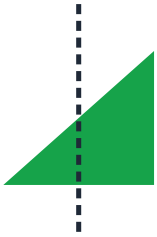

Task card 7 Matching Sides (Symmetry)

Does the right side match the left side like a mirror? Write yes or no.

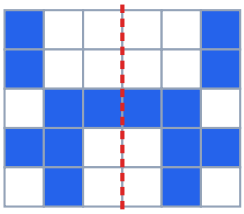

Task card 8 Matching Sides (Symmetry)

Does the dashed line cut this shape into two sides that match? Write yes or no.



Task card 9 Matching Sides (Symmetry)

Does the right side match the left side like a mirror? Write yes or no.

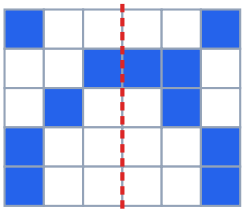

Task card 10 Matching Sides (Symmetry)

Does the dashed line cut this shape into two sides that match? Write yes or no.



Task card 11 Matching Sides (Symmetry)

Does the right side match the left side like a mirror? Write yes or no.

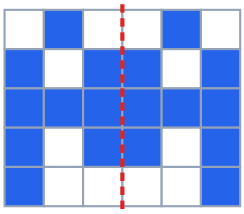

Task card 12 Matching Sides (Symmetry)

Does the dashed line cut this shape into two sides that match? Write yes or no.



Task card 13 Matching Sides (Symmetry)

Does the right side match the left side like a mirror? Write yes or no.

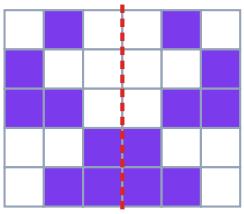

Task card 14 Matching Sides (Symmetry)

Does the right side match the left side like a mirror? Write yes or no.

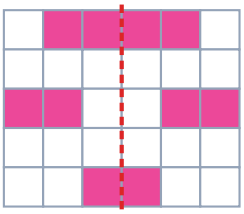

Task card 15 Matching Sides (Symmetry)

Does the dashed line cut this shape into two sides that match? Write yes or no.



Task card 16 Matching Sides (Symmetry)

Does the right side match the left side like a mirror? Write yes or no.

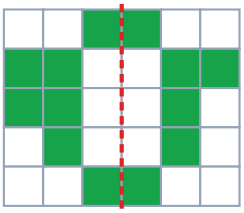

Task card 17 Matching Sides (Symmetry)

Does the dashed line cut this shape into two sides that match? Write yes or no.



Task card 18 Matching Sides (Symmetry)

Does the right side match the left side like a mirror? Write yes or no.

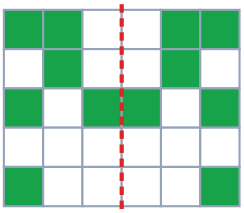

Task card 19 Matching Sides (Symmetry)

Does the dashed line cut this shape into two sides that match? Write yes or no.

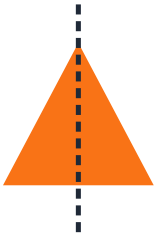

Task card 20 Matching Sides (Symmetry)

Does the right side match the left side like a mirror? Write yes or no.

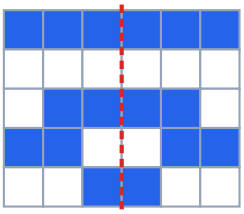

Task card 21 Matching Sides (Symmetry)

Does the dashed line cut this shape into two sides that match? Write yes or no.



Task card 22 Matching Sides (Symmetry)

Does the right side match the left side like a mirror? Write yes or no.

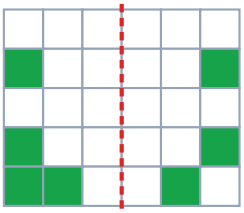

Task card 23 Matching Sides (Symmetry)

Does the dashed line cut this shape into two sides that match? Write yes or no.



Task card 24 Matching Sides (Symmetry)

Does the right side match the left side like a mirror? Write yes or no.

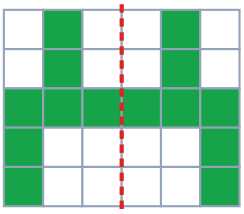

Matching Sides (Symmetry) Task Cards

Recording sheet · Preschool · Look at both sides of the dashed line. Write yes or no.

Name: _____ Date: _____

Scan to check your answers

1	2	3	4
5	6	7	8
9	10	11	12
13	14	15	16
17	18	19	20
21	22	23	24

Matching Sides (Symmetry) Task Cards: Answer Key

Preschool · Hard

The answers online

1. no	**2.** yes	**3.** no
4. yes	**5.** yes	**6.** no
7. yes	**8.** no	**9.** no
10. no	**11.** yes	**12.** yes
13. yes	**14.** yes	**15.** no
16. no	**17.** no	**18.** yes
19. yes	**20.** yes	**21.** yes
22. no	**23.** yes	**24.** yes