Matching Sides (Symmetry) · 1

Does the right side match the left side like a mirror? Write yes or no.

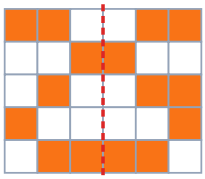

Matching Sides (Symmetry) · 2

Does the dashed line cut this shape into two sides that match? Write yes or no.



Matching Sides (Symmetry) · 3

Does the right side match the left side like a mirror? Write yes or no.

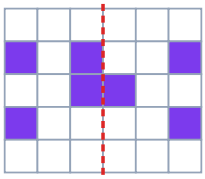

Matching Sides (Symmetry) · 4

Does the dashed line cut this shape into two sides that match? Write yes or no.



Matching Sides (Symmetry) · 5

Does the right side match the left side like a mirror? Write yes or no.

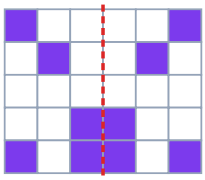

Matching Sides (Symmetry) · 6

Does the dashed line cut this shape into two sides that match? Write yes or no.



Matching Sides (Symmetry) · 7

Does the right side match the left side like a mirror? Write yes or no.

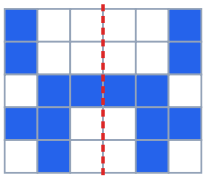

Matching Sides (Symmetry) · 8

Does the dashed line cut this shape into two sides that match? Write yes or no.



Matching Sides (Symmetry) · 2

ANSWER

yes

Matching Sides (Symmetry) · 1

ANSWER

no

Matching Sides (Symmetry) · 4

ANSWER

yes

Matching Sides (Symmetry) · 3

ANSWER

no

Matching Sides (Symmetry) · 6

ANSWER

no

Matching Sides (Symmetry) · 5

ANSWER

yes

Matching Sides (Symmetry) · 8

ANSWER

no

Matching Sides (Symmetry) · 7

ANSWER

yes

Matching Sides (Symmetry) · 9

Does the right side match the left side like a mirror? Write yes or no.

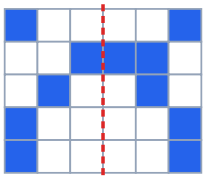

Matching Sides (Symmetry) · 10

Does the dashed line cut this shape into two sides that match? Write yes or no.



Matching Sides (Symmetry) · 11

Does the right side match the left side like a mirror? Write yes or no.

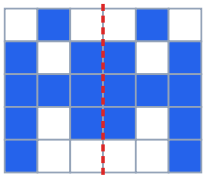

Matching Sides (Symmetry) · 12

Does the dashed line cut this shape into two sides that match? Write yes or no.



Matching Sides (Symmetry) · 13

Does the right side match the left side like a mirror? Write yes or no.

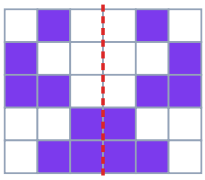

Matching Sides (Symmetry) · 14

Does the right side match the left side like a mirror? Write yes or no.

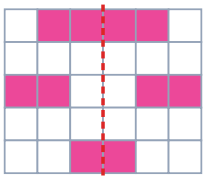

Matching Sides (Symmetry) · 15

Does the dashed line cut this shape into two sides that match? Write yes or no.



Matching Sides (Symmetry) · 16

Does the right side match the left side like a mirror? Write yes or no.

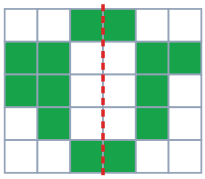

Matching Sides (Symmetry) · 10

ANSWER

no

Matching Sides (Symmetry) · 9

ANSWER

no

Matching Sides (Symmetry) · 12

ANSWER

yes

Matching Sides (Symmetry) · 11

ANSWER

yes

Matching Sides (Symmetry) · 14

ANSWER

yes

Matching Sides (Symmetry) · 13

ANSWER

yes

Matching Sides (Symmetry) · 16

ANSWER

no

Matching Sides (Symmetry) · 15

ANSWER

no

Matching Sides (Symmetry) · 17

Does the dashed line cut this shape into two sides that match? Write yes or no.



Matching Sides (Symmetry) · 18

Does the right side match the left side like a mirror? Write yes or no.

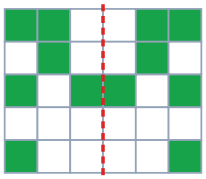

Matching Sides (Symmetry) · 19

Does the dashed line cut this shape into two sides that match? Write yes or no.



Matching Sides (Symmetry) · 20

Does the right side match the left side like a mirror? Write yes or no.

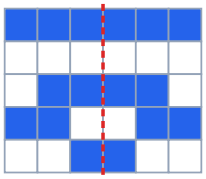

Matching Sides (Symmetry) · 21

Does the dashed line cut this shape into two sides that match? Write yes or no.



Matching Sides (Symmetry) · 22

Does the right side match the left side like a mirror? Write yes or no.

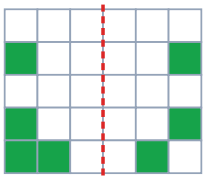

Matching Sides (Symmetry) · 23

Does the dashed line cut this shape into two sides that match? Write yes or no.



Matching Sides (Symmetry) · 24

Does the right side match the left side like a mirror? Write yes or no.

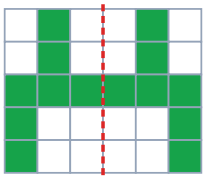

Matching Sides (Symmetry) · 18

ANSWER

yes

Matching Sides (Symmetry) · 17

ANSWER

no

Matching Sides (Symmetry) · 20

ANSWER

yes

Matching Sides (Symmetry) · 19

ANSWER

yes

Matching Sides (Symmetry) · 22

ANSWER

no

Matching Sides (Symmetry) · 21

ANSWER

yes

Matching Sides (Symmetry) · 24

ANSWER

yes

Matching Sides (Symmetry) · 23

ANSWER

yes