Sorting & Classifying · 1

Which one does not belong?

Write its number.



1 2 3 4 5

Sorting & Classifying · 2

How many red shapes are there?



Sorting & Classifying · 3

Which one does not belong?

Write its number.



1 2 3 4 5

Sorting & Classifying · 4

How many squares are there?



Sorting & Classifying · 5

Which one does not belong?

Write its number.



1 2 3 4 5

Sorting & Classifying · 6

How many circles are there?



Sorting & Classifying · 7

Which one does not belong?

Write its number.



1 2 3 4 5

Sorting & Classifying · 8

How many red shapes are there?



Sorting & Classifying · 2

**ANSWER**

**3**

Sorting & Classifying · 1

**ANSWER**

**5**

Sorting & Classifying · 4

**ANSWER**

**5**

Sorting & Classifying · 3

**ANSWER**

**4**

Sorting & Classifying · 6

**ANSWER**

**6**

Sorting & Classifying · 5

**ANSWER**

**4**

Sorting & Classifying · 8

**ANSWER**

**4**

Sorting & Classifying · 7

**ANSWER**

**4**

Sorting & Classifying · 9

Which one does not belong?

Write its number.



1 2 3 4 5

Sorting & Classifying · 10

How many squares are there?



Sorting & Classifying · 11

Which one does not belong?

Write its number.



1 2 3 4 5

Sorting & Classifying · 12

How many red shapes are there?



Sorting & Classifying · 13

Which one does not belong?

Write its number.



1 2 3 4 5

Sorting & Classifying · 14

How many circles are there?



Sorting & Classifying · 15

Which one does not belong?

Write its number.



1 2 3 4 5

Sorting & Classifying · 16

How many circles are there?



Sorting & Classifying · 10

**ANSWER**

**6**

Sorting & Classifying · 9

**ANSWER**

**3**

Sorting & Classifying · 12

**ANSWER**

**3**

Sorting & Classifying · 11

**ANSWER**

**2**

Sorting & Classifying · 14

**ANSWER**

**5**

Sorting & Classifying · 13

**ANSWER**

**3**

Sorting & Classifying · 16

**ANSWER**

**5**

Sorting & Classifying · 15

**ANSWER**

**3**

Sorting & Classifying · 17

Which one does not belong?

Write its number.



1 2 3 4 5

Sorting & Classifying · 18

How many red shapes are there?



Sorting & Classifying · 19

Which one does not belong?

Write its number.



1 2 3 4 5

Sorting & Classifying · 20

How many triangles are there?



Sorting & Classifying · 21

Which one does not belong?

Write its number.



1 2 3 4 5

Sorting & Classifying · 22

How many green shapes are there?



Sorting & Classifying · 23

Which one does not belong?

Write its number.



1 2 3 4 5

Sorting & Classifying · 24

How many squares are there?



Sorting & Classifying · 18

**ANSWER**

**4**

Sorting & Classifying · 17

**ANSWER**

**5**

Sorting & Classifying · 20

**ANSWER**

**6**

Sorting & Classifying · 19

**ANSWER**

**5**

Sorting & Classifying · 22

**ANSWER**

**4**

Sorting & Classifying · 21

**ANSWER**

**2**

Sorting & Classifying · 24

**ANSWER**

**5**

Sorting & Classifying · 23

**ANSWER**

**5**