More, Fewer, or Same · 1

Are there more balls or more apples?

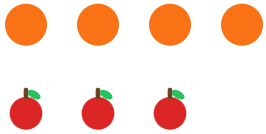

More, Fewer, or Same · 2

Are there fewer hearts or fewer apples?



More, Fewer, or Same · 3

Compare the balloons to the apples. Are there more balloons, fewer balloons, or the same number? Write more, fewer, or same.

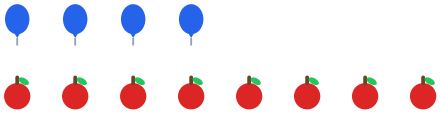

More, Fewer, or Same · 4

Are there fewer stars or fewer apples?



More, Fewer, or Same · 5

Are there more balls or more hearts?



More, Fewer, or Same · 6

Compare the hearts to the balloons. Are there more hearts, fewer hearts, or the same number? Write more, fewer, or same.



More, Fewer, or Same · 7

Are there more hearts or more stars?



More, Fewer, or Same · 8

Are there fewer hearts or fewer apples?



More, Fewer, or Same · 2

ANSWER

apples

More, Fewer, or Same · 1

ANSWER

balls

More, Fewer, or Same · 4

ANSWER

stars

More, Fewer, or Same · 3

ANSWER

fewer

More, Fewer, or Same · 6

ANSWER

more

More, Fewer, or Same · 5

ANSWER

hearts

More, Fewer, or Same · 8

ANSWER

hearts

More, Fewer, or Same · 7

ANSWER

stars

More, Fewer, or Same · 9

Are there more balls or more hearts?



More, Fewer, or Same · 10

Are there fewer apples or fewer balls?



More, Fewer, or Same · 11

Compare the balls to the balloons. Are there more balls, fewer balls, or the same number? Write more, fewer, or same.



More, Fewer, or Same · 12

Are there fewer apples or fewer balloons?



More, Fewer, or Same · 13

Are there more apples or more stars?



More, Fewer, or Same · 14

Compare the stars to the balloons. Are there more stars, fewer stars, or the same number? Write more, fewer, or same.



More, Fewer, or Same · 15

Are there more hearts or more balloons?



More, Fewer, or Same · 16

Are there fewer apples or fewer hearts?



More, Fewer, or Same · 10

ANSWER

balls

More, Fewer, or Same · 9

ANSWER

hearts

More, Fewer, or Same · 12

ANSWER

balloons

More, Fewer, or Same · 11

ANSWER

same

More, Fewer, or Same · 14

ANSWER

same

More, Fewer, or Same · 13

ANSWER

stars

More, Fewer, or Same · 16

ANSWER

hearts

More, Fewer, or Same · 15

ANSWER

hearts

More, Fewer, or Same · 17

Are there more balloons or more stars?



More, Fewer, or Same · 18

Are there fewer stars or fewer balloons?



More, Fewer, or Same · 19

Compare the stars to the balloons. Are there more stars, fewer stars, or the same number? Write more, fewer, or same.



More, Fewer, or Same · 20

Are there fewer apples or fewer balls?



More, Fewer, or Same · 21

Are there more hearts or more balloons?



More, Fewer, or Same · 22

Compare the apples to the balls. Are there more apples, fewer apples, or the same number? Write more, fewer, or same.



More, Fewer, or Same · 23

Are there more hearts or more apples?



More, Fewer, or Same · 24

Are there fewer stars or fewer balls?



More, Fewer, or Same · 18

ANSWER

stars

More, Fewer, or Same · 17

ANSWER

balloons

More, Fewer, or Same · 20

ANSWER

balls

More, Fewer, or Same · 19

ANSWER

fewer

More, Fewer, or Same · 22

ANSWER

same

More, Fewer, or Same · 21

ANSWER

hearts

More, Fewer, or Same · 24

ANSWER

stars

More, Fewer, or Same · 23

ANSWER

apples