Task card 1 Heavy & Light

Which box is heavier: the red box or the green box?



Task card 2 Heavy & Light

Which ball is lighter: the pink ball or the red ball?



Task card 3 Heavy & Light

The scale is level. The pink box weighs the same as how many blocks?

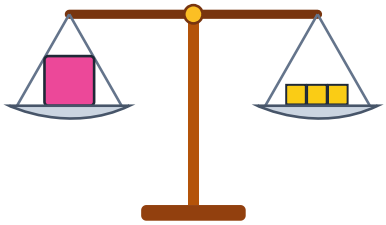

Task card 4 Heavy & Light

Which box is lighter: the purple box or the green box?

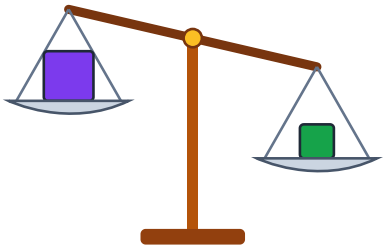

Task card 5 Heavy & Light

Which box is heavier: the orange box or the red box?



Task card 6 Heavy & Light

The scale is level. The blue ball weighs the same as how many blocks?

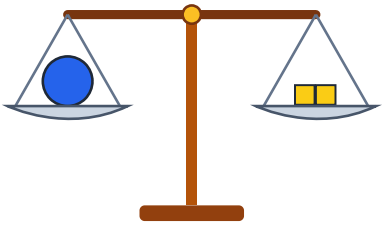

Task card 7 Heavy & Light

Which ball is heavier: the yellow ball or the pink ball?



Task card 8 Heavy & Light

Which box is lighter: the red box or the yellow box?



Task card 9 Heavy & Light

Which box is heavier: the purple box or the orange box?



Task card 10 Heavy & Light

Which ball is lighter: the green ball or the yellow ball?

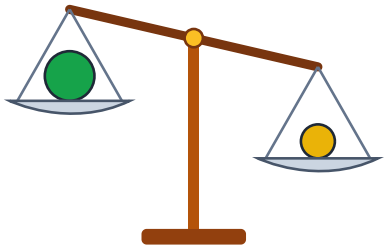

Task card 11 Heavy & Light

The scale is level. The green box weighs the same as how many blocks?

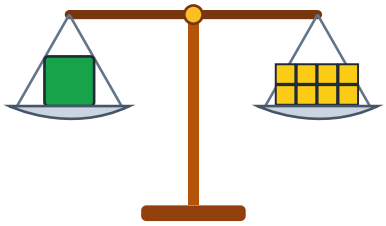

Task card 12 Heavy & Light

Which box is lighter: the blue box or the red box?



Task card 13 Heavy & Light

Which ball is heavier: the orange ball or the red ball?



Task card 14 Heavy & Light

The scale is level. The purple box weighs the same as how many blocks?

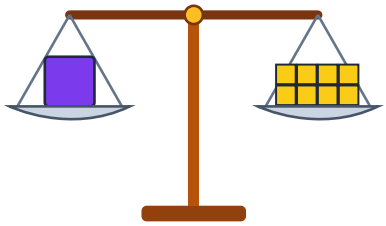

Task card 15 Heavy & Light

Which box is heavier: the yellow box or the green box?



Task card 16 Heavy & Light

Which ball is lighter: the pink ball or the yellow ball?



Task card 17 Heavy & Light

Which ball is heavier: the purple ball or the yellow ball?

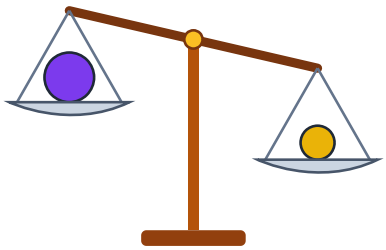

Task card 18 Heavy & Light

Which ball is lighter: the red ball or the yellow ball?



Task card 19 Heavy & Light

The scale is level. The yellow ball weighs the same as how many blocks?



Task card 20 Heavy & Light

Which box is lighter: the yellow box or the red box?



Task card 21 Heavy & Light

Which box is heavier: the blue box or the purple box?



Task card 22 Heavy & Light

The scale is level. The purple box weighs the same as how many blocks?

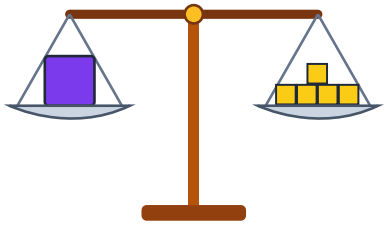

Task card 23 Heavy & Light

Which box is heavier: the red box or the pink box?



Task card 24 Heavy & Light

Which ball is lighter: the orange ball or the green ball?



Heavy & Light Task Cards

Recording sheet · Preschool · Look at the balance scale. Answer each question.

Name: _____ Date: _____

Scan to check your answers

1	2	3	4
5	6	7	8
9	10	11	12
13	14	15	16
17	18	19	20
21	22	23	24

Heavy & Light Task Cards: Answer Key

Preschool · Hard

The answers online

1. green	**2.** pink	**3.** 3
4. purple	**5.** orange	**6.** 2
7. yellow	**8.** red	**9.** orange
10. green	**11.** 8	**12.** blue
13. red	**14.** 8	**15.** yellow
16. yellow	**17.** yellow	**18.** red
19. 3	**20.** red	**21.** blue
22. 5	**23.** red	**24.** green