Heavy & Light · 1

Which box is heavier: the red box or the green box?

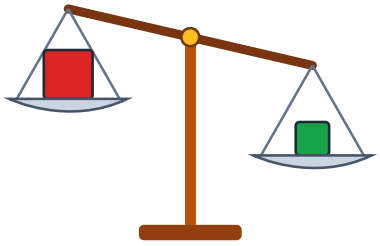

Heavy & Light · 2

Which ball is lighter: the pink ball or the red ball?



Heavy & Light · 3

The scale is level. The pink box weighs the same as how many blocks?

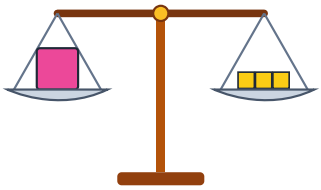

Heavy & Light · 4

Which box is lighter: the purple box or the green box?

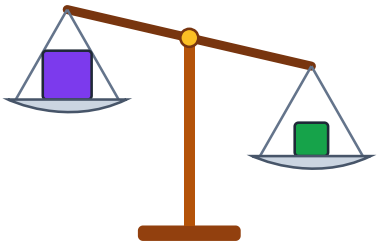

Heavy & Light · 5

Which box is heavier: the orange box or the red box?



Heavy & Light · 6

The scale is level. The blue ball weighs the same as how many blocks?

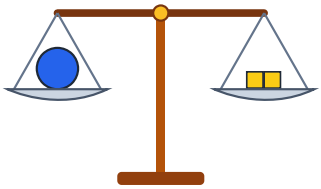

Heavy & Light · 7

Which ball is heavier: the yellow ball or the pink ball?



Heavy & Light · 8

Which box is lighter: the red box or the yellow box?

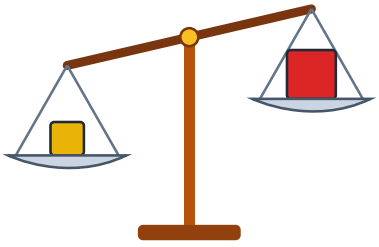

Heavy & Light · 2

ANSWER

pink

Heavy & Light · 1

ANSWER

green

Heavy & Light · 4

ANSWER

purple

Heavy & Light · 3

ANSWER

3

Heavy & Light · 6

ANSWER

2

Heavy & Light · 5

ANSWER

orange

Heavy & Light · 8

ANSWER

red

Heavy & Light · 7

ANSWER

yellow

Heavy & Light · 9

Which box is heavier: the purple box or the orange box?



Heavy & Light · 10

Which ball is lighter: the green ball or the yellow ball?



Heavy & Light · 11

The scale is level. The green box weighs the same as how many blocks?

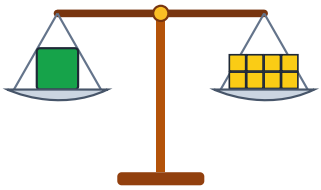

Heavy & Light · 12

Which box is lighter: the blue box or the red box?



Heavy & Light · 13

Which ball is heavier: the orange ball or the red ball?



Heavy & Light · 14

The scale is level. The purple box weighs the same as how many blocks?

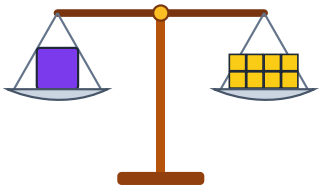

Heavy & Light · 15

Which box is heavier: the yellow box or the green box?



Heavy & Light · 16

Which ball is lighter: the pink ball or the yellow ball?



Heavy & Light · 10

ANSWER

green

Heavy & Light · 9

ANSWER

orange

Heavy & Light · 12

ANSWER

blue

Heavy & Light · 11

ANSWER

8

Heavy & Light · 14

ANSWER

8

Heavy & Light · 13

ANSWER

red

Heavy & Light · 16

ANSWER

yellow

Heavy & Light · 15

ANSWER

yellow

Heavy & Light · 17

Which ball is heavier: the purple ball or the yellow ball?



Heavy & Light · 18

Which ball is lighter: the red ball or the yellow ball?



Heavy & Light · 19

The scale is level. The yellow ball weighs the same as how many blocks?

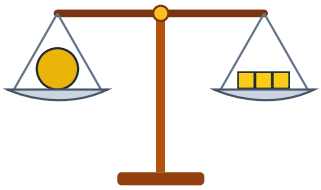

Heavy & Light · 20

Which box is lighter: the yellow box or the red box?

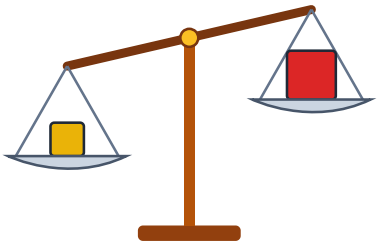

Heavy & Light · 21

Which box is heavier: the blue box or the purple box?

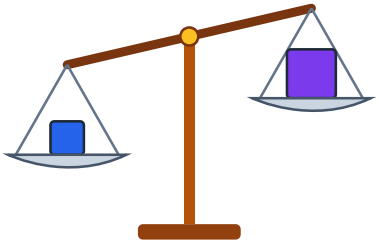

Heavy & Light · 22

The scale is level. The purple box weighs the same as how many blocks?

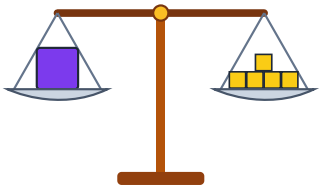

Heavy & Light · 23

Which box is heavier: the red box or the pink box?



Heavy & Light · 24

Which ball is lighter: the orange ball or the green ball?



Heavy & Light · 18

ANSWER

red

Heavy & Light · 17

ANSWER

yellow

Heavy & Light · 20

ANSWER

red

Heavy & Light · 19

ANSWER

3

Heavy & Light · 22

ANSWER

5

Heavy & Light · 21

ANSWER

blue

Heavy & Light · 24

ANSWER

green

Heavy & Light · 23

ANSWER

red