Whole & Half · 1

Is this shape cut into halves (two parts the same size)? Write yes or no.



Whole & Half · 2

Is the colored part a whole or a half?



Whole & Half · 3

Is this shape cut into halves (two parts the same size)? Write yes or no.

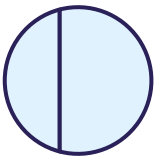

Whole & Half · 4

Is half of this shape colored? Write yes or no.



Whole & Half · 5

Is this shape cut into halves (two parts the same size)? Write yes or no.



Whole & Half · 6

Is the colored part a whole or a half?



Whole & Half · 7

Is this shape cut into halves (two parts the same size)? Write yes or no.



Whole & Half · 8

How many halves make a whole?

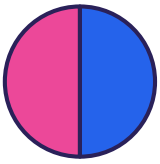

Whole & Half · 2

ANSWER

whole

Whole & Half · 1

ANSWER

no

Whole & Half · 4

ANSWER

yes

Whole & Half · 3

ANSWER

no

Whole & Half · 6

ANSWER

half

Whole & Half · 5

ANSWER

yes

Whole & Half · 8

ANSWER

2

Whole & Half · 7

ANSWER

no

Whole & Half · 9

Is this shape cut into halves (two parts the same size)? Write yes or no.

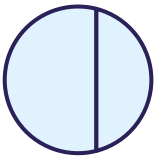

Whole & Half · 10

Is the colored part a whole or a half?



Whole & Half · 11

Is this shape cut into halves (two parts the same size)? Write yes or no.



Whole & Half · 12

Is half of this shape colored? Write yes or no.



Whole & Half · 13

How many equal parts is this shape cut into?



Whole & Half · 14

Is this shape cut into halves (two parts the same size)? Write yes or no.



Whole & Half · 15

Is this shape cut into halves (two parts the same size)? Write yes or no.



Whole & Half · 16

Is the colored part a whole or a half?



Whole & Half · 10

ANSWER

half

Whole & Half · 9

ANSWER

no

Whole & Half · 12

ANSWER

yes

Whole & Half · 11

ANSWER

yes

Whole & Half · 14

ANSWER

no

Whole & Half · 13

ANSWER

2

Whole & Half · 16

ANSWER

half

Whole & Half · 15

ANSWER

no

Whole & Half · 17

Is half of this shape colored? Write yes or no.



Whole & Half · 18

How many equal parts is this shape cut into?



Whole & Half · 19

Is this shape cut into halves (two parts the same size)? Write yes or no.



Whole & Half · 20

Is the colored part a whole or a half?

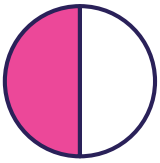

Whole & Half · 21

Is half of this shape colored? Write yes or no.



Whole & Half · 22

Is this shape cut into halves (two parts the same size)? Write yes or no.

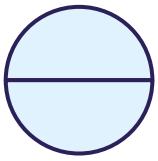

Whole & Half · 23

Is this shape cut into halves (two parts the same size)? Write yes or no.



Whole & Half · 24

Is this shape cut into halves (two parts the same size)? Write yes or no.

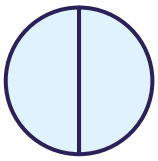

Whole & Half · 18

ANSWER

3

Whole & Half · 17

ANSWER

no

Whole & Half · 20

ANSWER

half

Whole & Half · 19

ANSWER

no

Whole & Half · 22

ANSWER

yes

Whole & Half · 21

ANSWER

no

Whole & Half · 24

ANSWER

yes

Whole & Half · 23

ANSWER

no