Full, Empty & Holds More · 1

Is this glass full, empty, or half full? Write full, empty, or half.



Full, Empty & Holds More · 2

Which cup has more water: the blue cup or the pink cup?

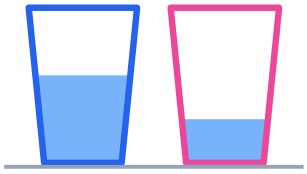

Full, Empty & Holds More · 3

Which cup has more water: the green cup or the purple cup?

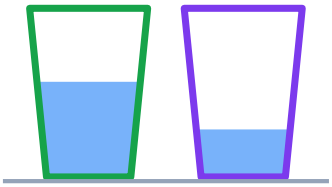

Full, Empty & Holds More · 4

Which cup can hold less water: the blue cup or the purple cup?

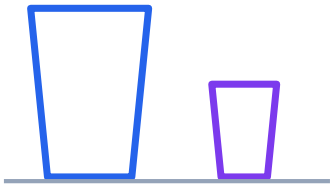

Full, Empty & Holds More · 5

Is this glass full, empty, or half full? Write full, empty, or half.



Full, Empty & Holds More · 6

Which cup has less water: the red cup or the blue cup?

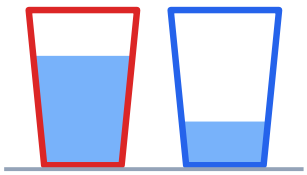

Full, Empty & Holds More · 7

Which cup has more water: the orange cup or the purple cup?

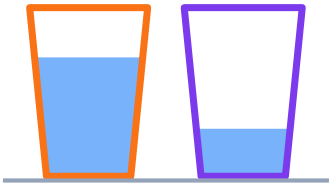

Full, Empty & Holds More · 8

Which cup can hold more water: the orange cup or the green cup?



Full, Empty & Holds More · 2

ANSWER

blue

Full, Empty & Holds More · 1

ANSWER

full

Full, Empty & Holds More · 4

ANSWER

purple

Full, Empty & Holds More · 3

ANSWER

green

Full, Empty & Holds More · 6

ANSWER

blue

Full, Empty & Holds More · 5

ANSWER

full

Full, Empty & Holds More · 8

ANSWER

orange

Full, Empty & Holds More · 7

ANSWER

orange

Full, Empty & Holds More · 9

Is this glass full, empty, or half full? Write full, empty, or half.



Full, Empty & Holds More · 10

Which cup has more water: the blue cup or the orange cup?



Full, Empty & Holds More · 11

Which cup has more water: the green cup or the pink cup?

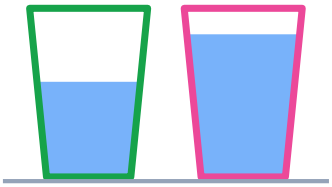

Full, Empty & Holds More · 12

Which cup can hold more water: the pink cup or the blue cup?

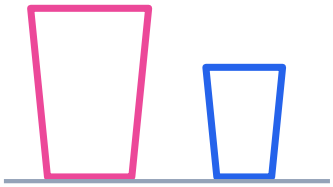

Full, Empty & Holds More · 13

Is this glass full, empty, or half full? Write full, empty, or half.



Full, Empty & Holds More · 14

Which cup has more water: the purple cup or the pink cup?

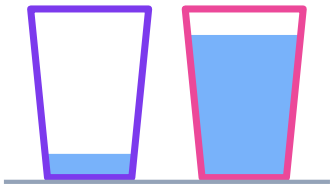

Full, Empty & Holds More · 15

Which cup has more water: the blue cup or the green cup?

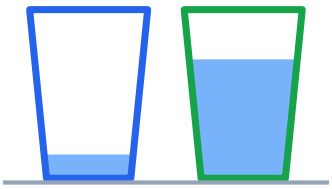

Full, Empty & Holds More · 16

Which cup can hold less water: the orange cup or the purple cup?



Full, Empty & Holds More · 10

ANSWER

blue

Full, Empty & Holds More · 9

ANSWER

half

Full, Empty & Holds More · 12

ANSWER

pink

Full, Empty & Holds More · 11

ANSWER

pink

Full, Empty & Holds More · 14

ANSWER

pink

Full, Empty & Holds More · 13

ANSWER

full

Full, Empty & Holds More · 16

ANSWER

orange

Full, Empty & Holds More · 15

ANSWER

green

Full, Empty & Holds More · 17

Is this glass full, empty, or half full? Write full, empty, or half.



Full, Empty & Holds More · 18

Which cup has the least water: purple, orange, or red?



Full, Empty & Holds More · 19

Which cup has more water: the purple cup or the pink cup?

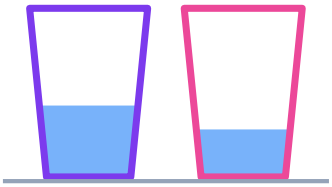

Full, Empty & Holds More · 20

Which cup can hold more water: the orange cup or the red cup?



Full, Empty & Holds More · 21

Is this glass full, empty, or half full? Write full, empty, or half.



Full, Empty & Holds More · 22

Which cup has the least water: purple, green, or pink?

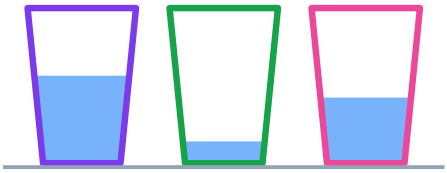

Full, Empty & Holds More · 23

Which cup has more water: the green cup or the orange cup?

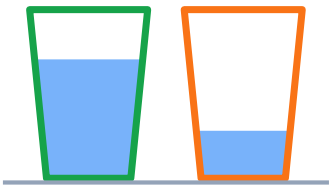

Full, Empty & Holds More · 24

Which cup can hold less water: the green cup or the pink cup?



Full, Empty & Holds More · 18

ANSWER

purple

Full, Empty & Holds More · 17

ANSWER

empty

Full, Empty & Holds More · 20

ANSWER

red

Full, Empty & Holds More · 19

ANSWER

purple

Full, Empty & Holds More · 22

ANSWER

green

Full, Empty & Holds More · 21

ANSWER

half

Full, Empty & Holds More · 24

ANSWER

pink

Full, Empty & Holds More · 23

ANSWER

green