Doubles to 10 · 1

Count the hearts in each row. How many in all? 2 + 2 = ___



Doubles to 10 · 2

Both sides of the domino have

4. 4 + 4 = ___



Doubles to 10 · 3

Count the apples in each row. How many in all? 3 + 3 = ___



Doubles to 10 · 4

Double 1 is ___.

Doubles to 10 · 5

Count the hearts in each row. How many in all? 3 + 3 = ___



Doubles to 10 · 6

Double 3 is ___.

Doubles to 10 · 7

Both sides of the domino have

3. 3 + 3 = ___



Doubles to 10 · 8

Both sides of the domino have

2. 2 + 2 = ___



Doubles to 10 · 2

ANSWER

8

Doubles to 10 · 1

ANSWER

4

Doubles to 10 · 4

ANSWER

2

Doubles to 10 · 3

ANSWER

6

Doubles to 10 · 6

ANSWER

6

Doubles to 10 · 5

ANSWER

6

Doubles to 10 · 8

ANSWER

4

Doubles to 10 · 7

ANSWER

6

Doubles to 10 · 9

Count the balls in each row. How many in all? 1 + 1 = ___



Doubles to 10 · 10

Both sides of the domino have 5. 5 + 5 = ___



Doubles to 10 · 11

Double 5 is ___.

Doubles to 10 · 12

Count the apples in each row. How many in all? 5 + 5 = ___



Doubles to 10 · 13

Count the balloons in each row. How many in all? 5 + 5 = ___



Doubles to 10 · 14

Count the balloons in each row. How many in all? 3 + 3 = ___



Doubles to 10 · 15

___ + ___ = 6. Both numbers are the same. What is the number?

Doubles to 10 · 16

Count the stars in each row. How many in all? 1 + 1 = ___



Doubles to 10 · 10

ANSWER

10

Doubles to 10 · 9

ANSWER

2

Doubles to 10 · 12

ANSWER

10

Doubles to 10 · 11

ANSWER

10

Doubles to 10 · 14

ANSWER

6

Doubles to 10 · 13

ANSWER

10

Doubles to 10 · 16

ANSWER

2

Doubles to 10 · 15

ANSWER

3

Doubles to 10 · 17

Double 2 is ___.

Doubles to 10 · 18

Count the balls in each row. How many in all? 2 + 2 = ___



Doubles to 10 · 19

Count the stars in each row. How many in all? 3 + 3 = ___



Doubles to 10 · 20

Both sides of the domino have

1. 1 + 1 = ___



Doubles to 10 · 21

Double 4 is ___.

Doubles to 10 · 22

Count the balloons in each row. How many in all? 1 + 1 = ___



Doubles to 10 · 23

Count the apples in each row. How many in all? 2 + 2 = ___



Doubles to 10 · 24

Count the apples in each row. How many in all? 4 + 4 = ___



Doubles to 10 · 18

ANSWER

4

Doubles to 10 · 17

ANSWER

4

Doubles to 10 · 20

ANSWER

2

Doubles to 10 · 19

ANSWER

6

Doubles to 10 · 22

ANSWER

2

Doubles to 10 · 21

ANSWER

8

Doubles to 10 · 24

ANSWER

8

Doubles to 10 · 23

ANSWER

4