Task card 1 Simple Data

There are 2 red balloons and 9 blue balloons. How many are there in all?



Task card 2 Simple Data

There are 10 blue stars and 4 yellow stars. How many more blue stars are there than yellow stars?



Task card 3 Simple Data

There are 9 red balloons and 8 blue balloons. How many are there in all?



Task card 4 Simple Data

There are 8 red apples and 5 green apples. How many more red apples are there than green apples?



Task card 5 Simple Data

There are 6 pink hearts and 4 purple hearts. How many are there in all?



Task card 6 Simple Data

There are 7 red apples and 3 green apples. How many more red apples are there than green apples?



Task card 7 Simple Data

There are 6 red apples and 2 green apples. How many are there in all?



Task card 8 Simple Data

There are 10 red apples and 6 green apples. How many more red apples are there than green apples?

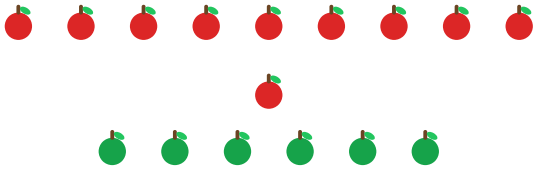

Task card 9 Simple Data

There are 2 red balloons and 7 blue balloons. How many are there in all?



Task card 10 Simple Data

There are 10 purple hearts and 3 pink hearts. How many more purple hearts are there than pink hearts?



Task card 11 Simple Data

There are 3 pink hearts and 1 purple heart. How many are there in all?



Task card 12 Simple Data

There are 8 pink hearts and 7 purple hearts. How many more pink hearts are there than purple hearts?



Task card 13 Simple Data

There is 1 yellow star and 2 blue stars. How many are there in all?



Task card 14 Simple Data

There are 9 blue stars and 4 yellow stars. How many more blue stars are there than yellow stars?



Task card 15 Simple Data

There are 9 yellow stars and 10 blue stars. How many are there in all?



Task card 16 Simple Data

There are 5 green apples and 3 red apples. How many more green apples are there than red apples?



Task card 17 Simple Data

There are 2 red balloons and 3 blue balloons. How many are there in all?

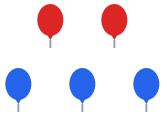

Task card 18 Simple Data

There are 10 blue stars and 7 yellow stars. How many more blue stars are there than yellow stars?



Task card 19 Simple Data

There are 8 red apples and 3 green apples. How many are there in all?



Task card 20 Simple Data

There are 8 purple hearts and 1 pink heart. How many more purple hearts are there than pink hearts?



Task card 21 Simple Data

There are 6 yellow stars and 3 blue stars. How many are there in all?



Task card 22 Simple Data

There are 7 green apples and 4 red apples. How many more green apples are there than red apples?



Task card 23 Simple Data

There are 4 red balloons and 7 blue balloons. How many are there in all?



Task card 24 Simple Data

There are 4 green apples and 2 red apples. How many more green apples are there than red apples?



Simple Data Task Cards

Recording sheet · Preschool · Answer each question.

Name: _____ Date: _____

Scan to check your answers

1	2	3	4
5	6	7	8
9	10	11	12
13	14	15	16
17	18	19	20
21	22	23	24

Simple Data Task Cards: Answer Key

Preschool · Hard

The answers online

1. 11	**2.** 6	**3.** 17
4. 3	**5.** 10	**6.** 4
7. 8	**8.** 4	**9.** 9
10. 7	**11.** 4	**12.** 1
13. 3	**14.** 5	**15.** 19
16. 2	**17.** 5	**18.** 3
19. 11	**20.** 7	**21.** 9
22. 3	**23.** 11	**24.** 2