Task card 1 Simple Data

There are 2 yellow stars and 3 blue stars. How many are there in all?



Task card 2 Simple Data

There are 5 blue stars and 4 yellow stars. How many more blue stars are there than yellow stars?



Task card 3 Simple Data

There are 4 red apples and 2 green apples. How many are there in all?



Task card 4 Simple Data

There are 5 pink hearts and 1 purple heart. How many more pink hearts are there than purple hearts?



Task card 5 Simple Data

There is 1 red apple and 2 green apples. How many are there in all?



Task card 6 Simple Data

There are 5 green apples and 3 red apples. How many more green apples are there than red apples?



Task card 7 Simple Data

There are 3 yellow stars and 4 blue stars. How many are there in all?



Task card 8 Simple Data

There are 4 red apples and 2 green apples. How many more red apples are there than green apples?



Task card 9 Simple Data

There are 4 yellow stars and 5 blue stars. How many are there in all?



Task card 10 Simple Data

There are 5 purple hearts and 1 pink heart. How many more purple hearts are there than pink hearts?



Task card 11 Simple Data

There are 6 red balloons and 5 blue balloons. How many are there in all?

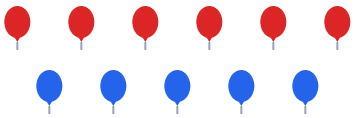

Task card 12 Simple Data

There are 4 purple hearts and 3 pink hearts. How many more purple hearts are there than pink hearts?



Task card 13 Simple Data

There are 4 red apples and 6 green apples. How many are there in all?



Task card 14 Simple Data

There are 6 red apples and 3 green apples. How many more red apples are there than green apples?



Task card 15 Simple Data

There are 3 pink hearts and 4 purple hearts. How many are there in all?



Task card 16 Simple Data

There are 4 purple hearts and 1 pink heart. How many more purple hearts are there than pink hearts?



Task card 17 Simple Data

There are 3 red apples and 2 green apples. How many are there in all?



Task card 18 Simple Data

There are 6 pink hearts and 2 purple hearts. How many more pink hearts are there than purple hearts?



Task card 19 Simple Data

There are 6 red balloons and 2 blue balloons. How many are there in all?



Task card 20 Simple Data

There are 7 yellow stars and 6 blue stars. How many more yellow stars are there than blue stars?



Task card 21 Simple Data

There are 4 red balloons and 3 blue balloons. How many are there in all?



Task card 22 Simple Data

There are 7 blue stars and 1 yellow star. How many more blue stars are there than yellow stars?



Task card 23 Simple Data

There are 4 yellow stars and 3 blue stars. How many are there in all?



Task card 24 Simple Data

There are 7 red apples and 5 green apples. How many more red apples are there than green apples?



Simple Data Task Cards

Recording sheet · Preschool · Answer each question.

Name: _____ Date: _____

Scan to check your answers

1	2	3	4
5	6	7	8
9	10	11	12
13	14	15	16
17	18	19	20
21	22	23	24

Simple Data Task Cards: Answer Key

Preschool · Easy

The answers online

1. 5	**2.** 1	**3.** 6
4. 4	**5.** 3	**6.** 2
7. 7	**8.** 2	**9.** 9
10. 4	**11.** 11	**12.** 1
13. 10	**14.** 3	**15.** 7
16. 3	**17.** 5	**18.** 4
19. 8	**20.** 1	**21.** 7
22. 6	**23.** 7	**24.** 2