Simple Data · 1

There are 2 red balloons and 9 blue balloons. How many are there in all?

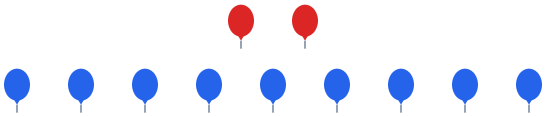

Simple Data · 2

There are 10 blue stars and 4 yellow stars. How many more blue stars are there than yellow stars?



Simple Data · 3

There are 9 red balloons and 8 blue balloons. How many are there in all?



Simple Data · 4

There are 8 red apples and 5 green apples. How many more red apples are there than green apples?



Simple Data · 5

There are 6 pink hearts and 4 purple hearts. How many are there in all?



Simple Data · 6

There are 7 red apples and 3 green apples. How many more red apples are there than green apples?



Simple Data · 7

There are 6 red apples and 2 green apples. How many are there in all?



Simple Data · 8

There are 10 red apples and 6 green apples. How many more red apples are there than green apples?



Simple Data · 2

ANSWER

6

Simple Data · 1

ANSWER

11

Simple Data · 4

ANSWER

3

Simple Data · 3

ANSWER

17

Simple Data · 6

ANSWER

4

Simple Data · 5

ANSWER

10

Simple Data · 8

ANSWER

4

Simple Data · 7

ANSWER

8

Simple Data · 9

There are 2 red balloons and 7 blue balloons. How many are there in all?

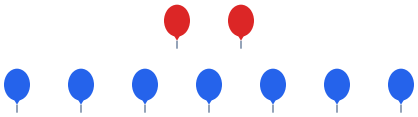

Simple Data · 10

There are 10 purple hearts and 3 pink hearts. How many more purple hearts are there than pink hearts?



Simple Data · 11

There are 3 pink hearts and 1 purple heart. How many are there in all?



Simple Data · 12

There are 8 pink hearts and 7 purple hearts. How many more pink hearts are there than purple hearts?



Simple Data · 13

There is 1 yellow star and 2 blue stars. How many are there in all?



Simple Data · 14

There are 9 blue stars and 4 yellow stars. How many more blue stars are there than yellow stars?



Simple Data · 15

There are 9 yellow stars and 10 blue stars. How many are there in all?



Simple Data · 16

There are 5 green apples and 3 red apples. How many more green apples are there than red apples?



Simple Data · 10

ANSWER

7

Simple Data · 9

ANSWER

9

Simple Data · 12

ANSWER

1

Simple Data · 11

ANSWER

4

Simple Data · 14

ANSWER

5

Simple Data · 13

ANSWER

3

Simple Data · 16

ANSWER

2

Simple Data · 15

ANSWER

19

Simple Data · 17

There are 2 red balloons and 3 blue balloons. How many are there in all?



Simple Data · 18

There are 10 blue stars and 7 yellow stars. How many more blue stars are there than yellow stars?



Simple Data · 19

There are 8 red apples and 3 green apples. How many are there in all?



Simple Data · 20

There are 8 purple hearts and 1 pink heart. How many more purple hearts are there than pink hearts?



Simple Data · 21

There are 6 yellow stars and 3 blue stars. How many are there in all?



Simple Data · 22

There are 7 green apples and 4 red apples. How many more green apples are there than red apples?



Simple Data · 23

There are 4 red balloons and 7 blue balloons. How many are there in all?



Simple Data · 24

There are 4 green apples and 2 red apples. How many more green apples are there than red apples?



Simple Data · 18

ANSWER

3

Simple Data · 17

ANSWER

5

Simple Data · 20

ANSWER

7

Simple Data · 19

ANSWER

11

Simple Data · 22

ANSWER

3

Simple Data · 21

ANSWER

9

Simple Data · 24

ANSWER

2

Simple Data · 23

ANSWER

11