Simple Data · 1

There are 2 yellow stars and 3 blue stars. How many are there in all?



Simple Data · 2

There are 5 blue stars and 4 yellow stars. How many more blue stars are there than yellow stars?



Simple Data · 3

There are 4 red apples and 2 green apples. How many are there in all?



Simple Data · 4

There are 5 pink hearts and 1 purple heart. How many more pink hearts are there than purple hearts?



Simple Data · 5

There is 1 red apple and 2 green apples. How many are there in all?



Simple Data · 6

There are 5 green apples and 3 red apples. How many more green apples are there than red apples?



Simple Data · 7

There are 3 yellow stars and 4 blue stars. How many are there in all?



Simple Data · 8

There are 4 red apples and 2 green apples. How many more red apples are there than green apples?



Simple Data · 2

ANSWER

1

Simple Data · 1

ANSWER

5

Simple Data · 4

ANSWER

4

Simple Data · 3

ANSWER

6

Simple Data · 6

ANSWER

2

Simple Data · 5

ANSWER

3

Simple Data · 8

ANSWER

2

Simple Data · 7

ANSWER

7

Simple Data · 9

There are 4 yellow stars and 5 blue stars. How many are there in all?



Simple Data · 10

There are 5 purple hearts and 1 pink heart. How many more purple hearts are there than pink hearts?



Simple Data · 11

There are 6 red balloons and 5 blue balloons. How many are there in all?

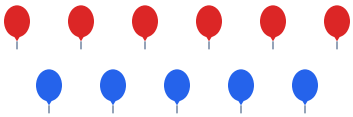

Simple Data · 12

There are 4 purple hearts and 3 pink hearts. How many more purple hearts are there than pink hearts?



Simple Data · 13

There are 4 red apples and 6 green apples. How many are there in all?



Simple Data · 14

There are 6 red apples and 3 green apples. How many more red apples are there than green apples?



Simple Data · 15

There are 3 pink hearts and 4 purple hearts. How many are there in all?



Simple Data · 16

There are 4 purple hearts and 1 pink heart. How many more purple hearts are there than pink hearts?



Simple Data · 10

ANSWER

4

Simple Data · 9

ANSWER

9

Simple Data · 12

ANSWER

1

Simple Data · 11

ANSWER

11

Simple Data · 14

ANSWER

3

Simple Data · 13

ANSWER

10

Simple Data · 16

ANSWER

3

Simple Data · 15

ANSWER

7

Simple Data · 17

There are 3 red apples and 2 green apples. How many are there in all?



Simple Data · 18

There are 6 pink hearts and 2 purple hearts. How many more pink hearts are there than purple hearts?



Simple Data · 19

There are 6 red balloons and 2 blue balloons. How many are there in all?



Simple Data · 20

There are 7 yellow stars and 6 blue stars. How many more yellow stars are there than blue stars?



Simple Data · 21

There are 4 red balloons and 3 blue balloons. How many are there in all?

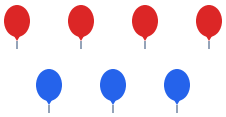

Simple Data · 22

There are 7 blue stars and 1 yellow star. How many more blue stars are there than yellow stars?



Simple Data · 23

There are 4 yellow stars and 3 blue stars. How many are there in all?



Simple Data · 24

There are 7 red apples and 5 green apples. How many more red apples are there than green apples?



Simple Data · 18

ANSWER

4

Simple Data · 17

ANSWER

5

Simple Data · 20

ANSWER

1

Simple Data · 19

ANSWER

8

Simple Data · 22

ANSWER

6

Simple Data · 21

ANSWER

7

Simple Data · 24

ANSWER

2

Simple Data · 23

ANSWER

7