Counting 11-20 · 1

How many balloons are there?



Counting 11-20 · 2

How many apples are there?



Counting 11-20 · 3

How many stars are there?



Counting 11-20 · 4

How many stars are there?



Counting 11-20 · 5

How many balloons are there?



Counting 11-20 · 6

How many apples are there?



Counting 11-20 · 7

How many apples are there?



Counting 11-20 · 8

How many apples are there?



Counting 11-20 · 2

ANSWER

19

Counting 11-20 · 1

ANSWER

20

Counting 11-20 · 4

ANSWER

20

Counting 11-20 · 3

ANSWER

16

Counting 11-20 · 6

ANSWER

18

Counting 11-20 · 5

ANSWER

16

Counting 11-20 · 8

ANSWER

15

Counting 11-20 · 7

ANSWER

16

Counting 11-20 · 9

How many balls are there?



Counting 11-20 · 10

How many balls are there?



Counting 11-20 · 11

How many balloons are there?



Counting 11-20 · 12

How many apples are there?

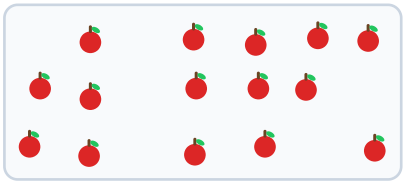

Counting 11-20 · 13

How many hearts are there?



Counting 11-20 · 14

How many apples are there?



Counting 11-20 · 15

How many balls are there?



Counting 11-20 · 16

How many hearts are there?



Counting 11-20 · 10

ANSWER

20

Counting 11-20 · 9

ANSWER

17

Counting 11-20 · 12

ANSWER

15

Counting 11-20 · 11

ANSWER

18

Counting 11-20 · 14

ANSWER

17

Counting 11-20 · 13

ANSWER

17

Counting 11-20 · 16

ANSWER

19

Counting 11-20 · 15

ANSWER

16

Counting 11-20 · 17

How many stars are there?



Counting 11-20 · 18

How many balls are there?



Counting 11-20 · 19

How many balls are there?



Counting 11-20 · 20

How many stars are there?



Counting 11-20 · 21

How many apples are there?



Counting 11-20 · 22

How many hearts are there?



Counting 11-20 · 23

How many stars are there?



Counting 11-20 · 24

How many hearts are there?



Counting 11-20 · 18

ANSWER

18

Counting 11-20 · 17

ANSWER

16

Counting 11-20 · 20

ANSWER

20

Counting 11-20 · 19

ANSWER

14

Counting 11-20 · 22

ANSWER

20

Counting 11-20 · 21

ANSWER

16

Counting 11-20 · 24

ANSWER

16

Counting 11-20 · 23

ANSWER

19