Counting 1-10 · 1

How many are there?



Counting 1-10 · 2

How many are there?



Counting 1-10 · 3

Count the stars. How many?



Counting 1-10 · 4

How many dots are in the frame?



Counting 1-10 · 5

How many dots are on the dice?



Counting 1-10 · 6

How many red balloons are there?



Counting 1-10 · 7

1 more balloon comes. How many balloons are there now?



Counting 1-10 · 8

Count the balls. How many?

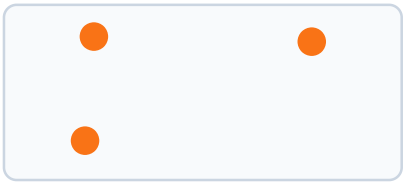

Counting 1-10 · 2

ANSWER

4

Counting 1-10 · 1

ANSWER

3

Counting 1-10 · 4

ANSWER

1

Counting 1-10 · 3

ANSWER

3

Counting 1-10 · 6

ANSWER

3

Counting 1-10 · 5

ANSWER

2

Counting 1-10 · 8

ANSWER

3

Counting 1-10 · 7

ANSWER

2

Counting 1-10 · 9

How many are there?



Counting 1-10 · 10

How many are there?



Counting 1-10 · 11

Count the stars. How many?

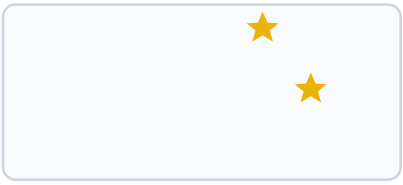

Counting 1-10 · 12

How many dots are on the dice?



Counting 1-10 · 13

How many red balloons are there?



Counting 1-10 · 14

1 more star comes. How many stars are there now?



Counting 1-10 · 15

Count the apples. How many?



Counting 1-10 · 16

How many are there?



Counting 1-10 · 10

ANSWER

3

Counting 1-10 · 9

ANSWER

4

Counting 1-10 · 12

ANSWER

4

Counting 1-10 · 11

ANSWER

2

Counting 1-10 · 14

ANSWER

3

Counting 1-10 · 13

ANSWER

4

Counting 1-10 · 16

ANSWER

6

Counting 1-10 · 15

ANSWER

3

Counting 1-10 · 17

How many are there?



Counting 1-10 · 18

Count the balloons. How many?

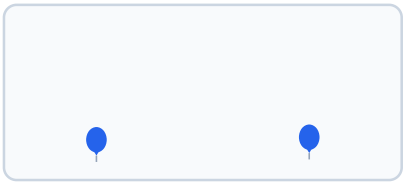

Counting 1-10 · 19

How many dots are in the frame?

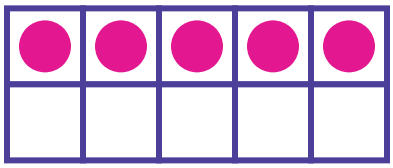

Counting 1-10 · 20

How many red balloons are there?



Counting 1-10 · 21

1 more apple comes. How many apples are there now?



Counting 1-10 · 22

Count the hearts. How many?

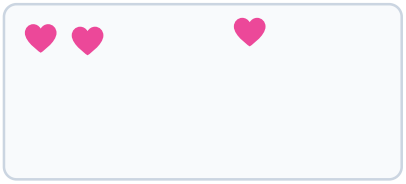

Counting 1-10 · 23

How many are there?



Counting 1-10 · 24

How many are there?



Counting 1-10 · 18

ANSWER

2

Counting 1-10 · 17

ANSWER

5

Counting 1-10 · 20

ANSWER

3

Counting 1-10 · 19

ANSWER

5

Counting 1-10 · 22

ANSWER

3

Counting 1-10 · 21

ANSWER

6

Counting 1-10 · 24

ANSWER

1

Counting 1-10 · 23

ANSWER

1