Task card 1 Counting to 100 by Tens

Each stick has 10 blocks. Count by tens. How many blocks are there?

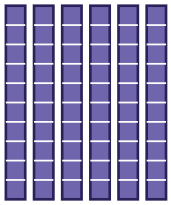

Task card 2 Counting to 100 by Tens

Count by tens.

30, 40, 50, ___

Task card 3 Counting to 100 by Tens

Each stick has 10 blocks. Count by tens. How many blocks are there?

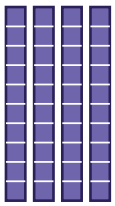

Task card 4 Counting to 100 by Tens

Count by tens.

60, 70, 80, ___

Task card 5 Counting to 100 by Tens

Each stick has 10 blocks. Count by tens. How many blocks are there?



Task card 6 Counting to 100 by Tens

Count by tens.

70, 80, 90, ___

Task card 7 Counting to 100 by Tens

Each stick has 10 blocks. Count by tens. How many blocks are there?

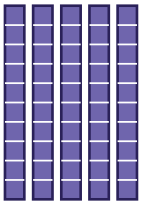

Task card 8 Counting to 100 by Tens

Count by tens.

50, 60, 70, ___

Task card 9 Counting to 100 by Tens

Each stick has 10 blocks. Count by tens. How many blocks are there?



Task card 10 Counting to 100 by Tens

Each stick has 10 blocks. Count by tens. How many blocks are there?



Task card 11 Counting to 100 by Tens

Count by tens.

40, 50, 60, ___

Task card 12 Counting to 100 by Tens

Each stick has 10 blocks. Count by tens. How many blocks are there?

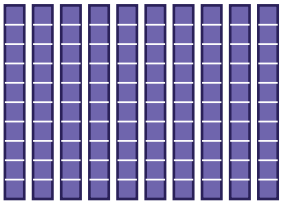

Task card 13 Counting to 100 by Tens

Count by tens.

20, 30, 40, ___

Task card 14 Counting to 100 by Tens

Count by tens.

10, 20, 30, ___

Task card 15 Counting to 100 by Tens

Each stick has 10 blocks. Count by tens. How many blocks are there?



Task card 16 Counting to 100 by Tens

Each stick has 10 blocks. Count by tens. How many blocks are there?

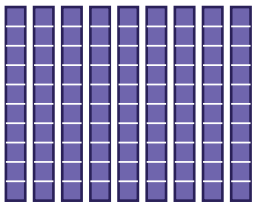

Counting to 100 by Tens Task Cards

Recording sheet · Preschool · Count by tens or by ones. Write the missing number.

Name: _____ Date: _____

Scan to check your answers

1	2	3	4
5	6	7	8
9	10	11	12
13	14	15	16

Counting to 100 by Tens Task Cards: Answer Key

Preschool · Easy

The answers online

1. 60	**2.** 60	**3.** 40
4. 90	**5.** 20	**6.** 100
7. 50	**8.** 80	**9.** 70
10. 80	**11.** 70	**12.** 100
13. 50	**14.** 40	**15.** 30
16. 90		