Counting to 100 by Tens · 1

Count by tens. 70, 80, 90, ___

Counting to 100 by Tens · 2

Each stick has 10 blocks. Count by tens. How many blocks are there?



Counting to 100 by Tens · 3

Count by tens. 20, 30, 40, ___

Counting to 100 by Tens · 4

Each stick has 10 blocks. Count by tens. How many blocks are there?



Counting to 100 by Tens · 5

Count by tens. 50, 60, 70, ___

Counting to 100 by Tens · 6

Count by ones. 28, 29, ___

Counting to 100 by Tens · 7

Count by tens. 60, ___, 80

Counting to 100 by Tens · 8

Count by ones. 98, 99, ___

Counting to 100 by Tens · 2

ANSWER

30

Counting to 100 by Tens · 1

ANSWER

100

Counting to 100 by Tens · 4

ANSWER

20

Counting to 100 by Tens · 3

ANSWER

50

Counting to 100 by Tens · 6

ANSWER

30

Counting to 100 by Tens · 5

ANSWER

80

Counting to 100 by Tens · 8

ANSWER

100

Counting to 100 by Tens · 7

ANSWER

70

Counting to 100 by Tens · 9

Count by tens. 40, ___, 60

Counting to 100 by Tens · 10

Count by ones. 38, 39, ___

Counting to 100 by Tens · 11

Count by ones. 48, 49, ___

Counting to 100 by Tens · 12

Count by tens. 50, ___, 70

Counting to 100 by Tens · 13

Count by tens. 80, ___, 100

Counting to 100 by Tens · 14

Count by tens. 10, 20, 30, ___

Counting to 100 by Tens · 15

Each stick has 10 blocks. Count by tens.

How many blocks are there?



Counting to 100 by Tens · 16

Count by ones. 88, 89, ___

Counting to 100 by Tens · 10

ANSWER

40

Counting to 100 by Tens · 9

ANSWER

50

Counting to 100 by Tens · 12

ANSWER

60

Counting to 100 by Tens · 11

ANSWER

50

Counting to 100 by Tens · 14

ANSWER

40

Counting to 100 by Tens · 13

ANSWER

90

Counting to 100 by Tens · 16

ANSWER

90

Counting to 100 by Tens · 15

ANSWER

80

Counting to 100 by Tens · 17

Count by tens. 10, ___, 30

Counting to 100 by Tens · 18

Count by ones. 78, 79, ___

Counting to 100 by Tens · 19

Count by tens. 40, 50, 60, ___

Counting to 100 by Tens · 20

Each stick has 10 blocks. Count by tens. How many blocks are there?

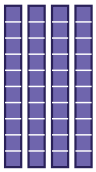

Counting to 100 by Tens · 21

Count by ones. 18, 19, ___

Counting to 100 by Tens · 22

Count by tens. 30, ___, 50

Counting to 100 by Tens · 23

Count by tens. 70, ___, 90

Counting to 100 by Tens · 24

Count by ones. 58, 59, ___

Counting to 100 by Tens · 18

ANSWER

80

Counting to 100 by Tens · 17

ANSWER

20

Counting to 100 by Tens · 20

ANSWER

40

Counting to 100 by Tens · 19

ANSWER

70

Counting to 100 by Tens · 22

ANSWER

40

Counting to 100 by Tens · 21

ANSWER

20

Counting to 100 by Tens · 24

ANSWER

60

Counting to 100 by Tens · 23

ANSWER

80