Counting to 100 by Tens · 1

Each stick has 10 blocks. Count by tens.

How many blocks are there?



Counting to 100 by Tens · 2

Count by tens. 30, 40, 50, ___

Counting to 100 by Tens · 3

Each stick has 10 blocks. Count by tens.

How many blocks are there?

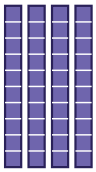

Counting to 100 by Tens · 4

Count by tens. 60, 70, 80, ___

Counting to 100 by Tens · 5

Each stick has 10 blocks. Count by tens.

How many blocks are there?



Counting to 100 by Tens · 6

Count by tens. 70, 80, 90, ___

Counting to 100 by Tens · 7

Each stick has 10 blocks. Count by tens.

How many blocks are there?



Counting to 100 by Tens · 8

Count by tens. 50, 60, 70, ___

Counting to 100 by Tens · 2

ANSWER

60

Counting to 100 by Tens · 1

ANSWER

60

Counting to 100 by Tens · 4

ANSWER

90

Counting to 100 by Tens · 3

ANSWER

40

Counting to 100 by Tens · 6

ANSWER

100

Counting to 100 by Tens · 5

ANSWER

20

Counting to 100 by Tens · 8

ANSWER

80

Counting to 100 by Tens · 7

ANSWER

50

Counting to 100 by Tens · 9

Each stick has 10 blocks. Count by tens.

How many blocks are there?



Counting to 100 by Tens · 10

Each stick has 10 blocks. Count by tens.

How many blocks are there?

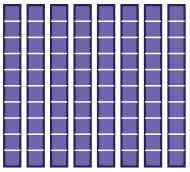

Counting to 100 by Tens · 11

Count by tens. 40, 50, 60, ___

Counting to 100 by Tens · 12

Each stick has 10 blocks. Count by tens.

How many blocks are there?



Counting to 100 by Tens · 13

Count by tens. 20, 30, 40, ___

Counting to 100 by Tens · 14

Count by tens. 10, 20, 30, ___

Counting to 100 by Tens · 15

Each stick has 10 blocks. Count by tens.

How many blocks are there?



Counting to 100 by Tens · 16

Each stick has 10 blocks. Count by tens.

How many blocks are there?

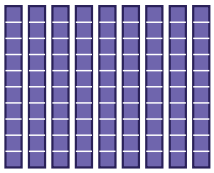

Counting to 100 by Tens · 10

ANSWER

80

Counting to 100 by Tens · 9

ANSWER

70

Counting to 100 by Tens · 12

ANSWER

100

Counting to 100 by Tens · 11

ANSWER

70

Counting to 100 by Tens · 14

ANSWER

40

Counting to 100 by Tens · 13

ANSWER

50

Counting to 100 by Tens · 16

ANSWER

90

Counting to 100 by Tens · 15

ANSWER

30