Counting by 2s and 5s · 1

The stars are in pairs. Count by 2s. How many stars in all?



Counting by 2s and 5s · 2

Each five frame has 5 dots. Count by 5s. How many dots in all?



Counting by 2s and 5s · 3

The apples are in pairs. Count by 2s. How many apples in all?

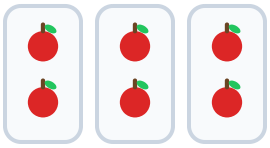

Counting by 2s and 5s · 4

Each five frame has 5 dots. Count by 5s. How many dots in all?

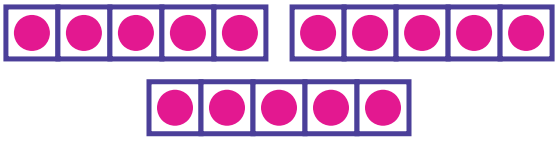

Counting by 2s and 5s · 5

The stars are in pairs. Count by 2s. How many stars in all?



Counting by 2s and 5s · 6

Each five frame has 5 dots. Count by 5s. How many dots in all?



Counting by 2s and 5s · 7

The stars are in pairs. Count by 2s. How many stars in all?



Counting by 2s and 5s · 8

The apples are in pairs. Count by 2s. How many apples in all?



Counting by 2s and 5s · 2

ANSWER

20

Counting by 2s and 5s · 1

ANSWER

12

Counting by 2s and 5s · 4

ANSWER

15

Counting by 2s and 5s · 3

ANSWER

6

Counting by 2s and 5s · 6

ANSWER

10

Counting by 2s and 5s · 5

ANSWER

14

Counting by 2s and 5s · 8

ANSWER

20

Counting by 2s and 5s · 7

ANSWER

8

Counting by 2s and 5s · 9

The apples are in pairs. Count by 2s. How many apples in all?

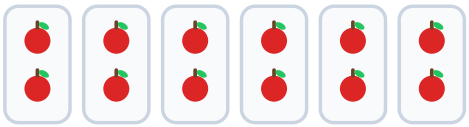

Counting by 2s and 5s · 10

The balls are in pairs. Count by 2s. How many balls in all?



Counting by 2s and 5s · 11

The balls are in pairs. Count by 2s. How many balls in all?



Counting by 2s and 5s · 12

The balloons are in pairs. Count by 2s. How many balloons in all?

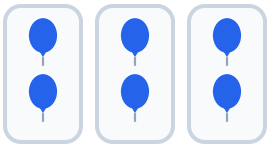

Counting by 2s and 5s · 13

Each five frame has 5 dots. Count by 5s. How many dots in all?



Counting by 2s and 5s · 14

The balls are in pairs. Count by 2s. How many balls in all?



Counting by 2s and 5s · 15

The stars are in pairs. Count by 2s. How many stars in all?



Counting by 2s and 5s · 16

The hearts are in pairs. Count by 2s. How many hearts in all?



Counting by 2s and 5s · 10

ANSWER

14

Counting by 2s and 5s · 9

ANSWER

12

Counting by 2s and 5s · 12

ANSWER

6

Counting by 2s and 5s · 11

ANSWER

18

Counting by 2s and 5s · 14

ANSWER

16

Counting by 2s and 5s · 13

ANSWER

30

Counting by 2s and 5s · 16

ANSWER

20

Counting by 2s and 5s · 15

ANSWER

16

Counting by 2s and 5s · 17

The balloons are in pairs. Count by 2s. How many balloons in all?

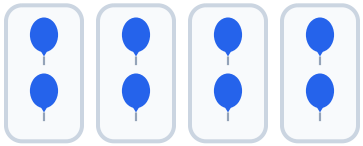

Counting by 2s and 5s · 18

The balloons are in pairs. Count by 2s. How many balloons in all?

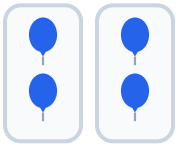

Counting by 2s and 5s · 19

Each five frame has 5 dots. Count by 5s. How many dots in all?

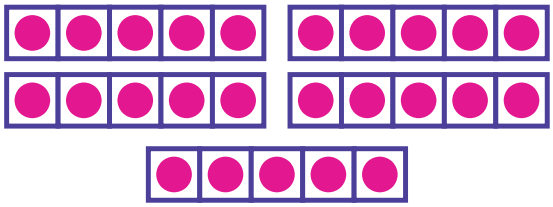

Counting by 2s and 5s · 20

The stars are in pairs. Count by 2s. How many stars in all?



Counting by 2s and 5s · 21

The hearts are in pairs. Count by 2s. How many hearts in all?



Counting by 2s and 5s · 22

The balloons are in pairs. Count by 2s. How many balloons in all?

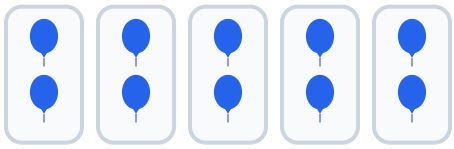

Counting by 2s and 5s · 23

The apples are in pairs. Count by 2s. How many apples in all?

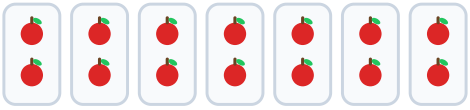

Counting by 2s and 5s · 18

ANSWER

4

Counting by 2s and 5s · 17

ANSWER

8

Counting by 2s and 5s · 20

ANSWER

10

Counting by 2s and 5s · 19

ANSWER

25

Counting by 2s and 5s · 22

ANSWER

10

Counting by 2s and 5s · 21

ANSWER

10

Counting by 2s and 5s · 23

ANSWER

14