Task card 1 Solid Shapes (3D)

What is this shape called: cylinder, sphere, cone, or cube?

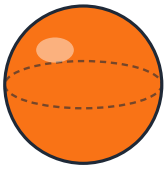

Task card 2 Solid Shapes (3D)

This is a can. What shape is it: cube, cylinder, cone, or sphere?



Task card 3 Solid Shapes (3D)

Can this shape roll? Write yes or no.

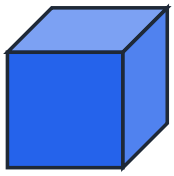

Task card 4 Solid Shapes (3D)

What is this shape called: cube, sphere, cylinder, or cone?



Task card 5 Solid Shapes (3D)

This is a traffic cone. What shape is it: cylinder, cube, cone, or sphere?



Task card 6 Solid Shapes (3D)

Can this shape roll? Write yes or no.



Task card 7 Solid Shapes (3D)

What is this shape called: sphere, cylinder, cone, or cube?

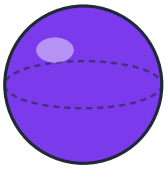

Task card 8 Solid Shapes (3D)

This is a dice. What shape is it: cone, sphere, cube, or cylinder?

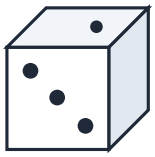

Task card 9 Solid Shapes (3D)

What is this shape called: sphere, cylinder, cube, or cone?



Task card 10 Solid Shapes (3D)

This is a drum. What shape is it: sphere, cone, cube, or cylinder?



Task card 11 Solid Shapes (3D)

Can this shape roll? Write yes or no.

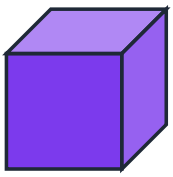

Task card 12 Solid Shapes (3D)

Can you stack another one on top of this shape? Write yes or no.

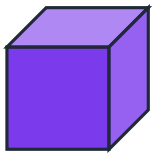

Task card 13 Solid Shapes (3D)

What is this shape called: cone, cube, cylinder, or sphere?



Task card 14 Solid Shapes (3D)

This is a gift box. What shape is it: cube, cone, cylinder, or sphere?



Task card 15 Solid Shapes (3D)

Can this shape roll? Write yes or no.



Task card 16 Solid Shapes (3D)

Can you stack another one on top of this shape? Write yes or no.



Task card 17 Solid Shapes (3D)

What is this shape called: cube, cone, sphere, or cylinder?



Task card 18 Solid Shapes (3D)

This is a can. What shape is it: cube, cone, cylinder, or sphere?



Task card 19 Solid Shapes (3D)

Can this shape roll? Write yes or no.



Task card 20 Solid Shapes (3D)

Can you stack another one on top of this shape? Write yes or no.



Task card 21 Solid Shapes (3D)

What is this shape called: cone, cube, sphere, or cylinder?



Task card 22 Solid Shapes (3D)

This is a party hat. What shape is it: cone, cylinder, sphere, or cube?



Task card 23 Solid Shapes (3D)

What is this shape called: cylinder, cone, cube, or sphere?

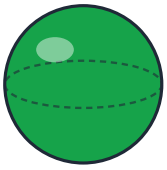

Task card 24 Solid Shapes (3D)

This is a ball. What shape is it: sphere, cone, cylinder, or cube?



Solid Shapes (3D) Task Cards

Recording sheet · Preschool · Look at each solid shape. Answer with a word from the question.

Name: _____ Date: _____

Scan to check your answers

1	2	3	4
5	6	7	8
9	10	11	12
13	14	15	16
17	18	19	20
21	22	23	24

Solid Shapes (3D) Task Cards: Answer Key

Preschool · Medium

The answers online

1. sphere	**2.** cylinder	**3.** no
4. cone	**5.** cone	**6.** yes
7. sphere	**8.** cube	**9.** cylinder
10. cylinder	**11.** no	**12.** yes
13. cone	**14.** cube	**15.** yes
16. yes	**17.** cylinder	**18.** cylinder
19. yes	**20.** no	**21.** cone
22. cone	**23.** sphere	**24.** sphere