Solid Shapes (3D) · 1

What is this shape called: cylinder, sphere, cone, or cube?

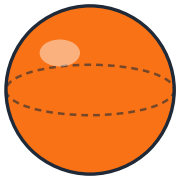

Solid Shapes (3D) · 2

This is a can. What shape is it: cube, cylinder, cone, or sphere?



Solid Shapes (3D) · 3

Can this shape roll? Write yes or no.

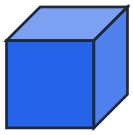

Solid Shapes (3D) · 4

What is this shape called: cube, sphere, cylinder, or cone?



Solid Shapes (3D) · 5

This is a traffic cone. What shape is it: cylinder, cube, cone, or sphere?



Solid Shapes (3D) · 6

Can this shape roll? Write yes or no.



Solid Shapes (3D) · 7

What is this shape called: sphere, cylinder, cone, or cube?

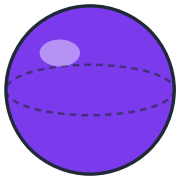

Solid Shapes (3D) · 8

This is a dice. What shape is it: cone, sphere, cube, or cylinder?

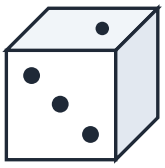

Solid Shapes (3D) · 2

ANSWER

cylinder

Solid Shapes (3D) · 1

ANSWER

sphere

Solid Shapes (3D) · 4

ANSWER

cone

Solid Shapes (3D) · 3

ANSWER

no

Solid Shapes (3D) · 6

ANSWER

yes

Solid Shapes (3D) · 5

ANSWER

cone

Solid Shapes (3D) · 8

ANSWER

cube

Solid Shapes (3D) · 7

ANSWER

sphere

Solid Shapes (3D) · 9

What is this shape called: sphere, cylinder, cube, or cone?



Solid Shapes (3D) · 10

This is a drum. What shape is it: sphere, cone, cube, or cylinder?



Solid Shapes (3D) · 11

Can this shape roll? Write yes or no.

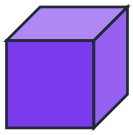

Solid Shapes (3D) · 12

Can you stack another one on top of this shape? Write yes or no.

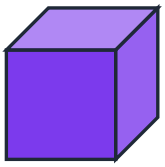

Solid Shapes (3D) · 13

What is this shape called: cone, cube, cylinder, or sphere?



Solid Shapes (3D) · 14

This is a gift box. What shape is it: cube, cone, cylinder, or sphere?



Solid Shapes (3D) · 15

Can this shape roll? Write yes or no.



Solid Shapes (3D) · 16

Can you stack another one on top of this shape? Write yes or no.



Solid Shapes (3D) · 10

ANSWER

cylinder

Solid Shapes (3D) · 9

ANSWER

cylinder

Solid Shapes (3D) · 12

ANSWER

yes

Solid Shapes (3D) · 11

ANSWER

no

Solid Shapes (3D) · 14

ANSWER

cube

Solid Shapes (3D) · 13

ANSWER

cone

Solid Shapes (3D) · 16

ANSWER

yes

Solid Shapes (3D) · 15

ANSWER

yes

Solid Shapes (3D) · 17

What is this shape called: cube, cone, sphere, or cylinder?



Solid Shapes (3D) · 18

This is a can. What shape is it: cube, cone, cylinder, or sphere?



Solid Shapes (3D) · 19

Can this shape roll? Write yes or no.



Solid Shapes (3D) · 20

Can you stack another one on top of this shape? Write yes or no.



Solid Shapes (3D) · 21

What is this shape called: cone, cube, sphere, or cylinder?



Solid Shapes (3D) · 22

This is a party hat. What shape is it: cone, cylinder, sphere, or cube?



Solid Shapes (3D) · 23

What is this shape called: cylinder, cone, cube, or sphere?

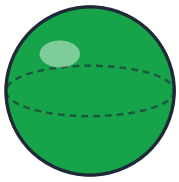

Solid Shapes (3D) · 24

This is a ball. What shape is it: sphere, cone, cylinder, or cube?



Solid Shapes (3D) · 18

ANSWER

cylinder

Solid Shapes (3D) · 17

ANSWER

cylinder

Solid Shapes (3D) · 20

ANSWER

no

Solid Shapes (3D) · 19

ANSWER

yes

Solid Shapes (3D) · 22

ANSWER

cone

Solid Shapes (3D) · 21

ANSWER

cone

Solid Shapes (3D) · 24

ANSWER

sphere

Solid Shapes (3D) · 23

ANSWER

sphere