Task card 1 Winter Math

Lily has 4 mittens. Lily gives 3 to Leo. How many mittens does Lily have left?



Task card 2 Winter Math

Noah has 9 snowmen. Noah gives 1 to Sam. How many snowmen does Noah have left?



Task card 3 Winter Math

Sam has 3 snowflakes. Ava brings 5 more. How many snowflakes are there now?



Task card 4 Winter Math

How many snowflakes are there?



Task card 5 Winter Math

Ella has 4 snowflakes. Sam brings 1 more. How many snowflakes are there now?



Task card 6 Winter Math

Noah has 3 snowflakes. Leo brings 2 more. How many snowflakes are there now?



Task card 7 Winter Math

How many snowmen are there?



Task card 8 Winter Math

Zoe has 2 snowflakes. Ella brings 3 more. How many snowflakes are there now?



Task card 9 Winter Math

Ben has 10 mittens. Ben gives 7 to Mia. How many mittens does Ben have left?



Task card 10 Winter Math

Lily has 2 snowflakes. Ben brings 4 more. How many snowflakes are there now?



Task card 11 Winter Math

Mia has 6 snowmen. Ava brings 3 more. How many snowmen are there now?



Task card 12 Winter Math

How many mittens are there?



Task card 13 Winter Math

How many mittens are there?



Task card 14 Winter Math

Ava has 2 snowflakes. Leo brings 8 more. How many snowflakes are there now?



Task card 15 Winter Math

Zoe has 5 snowmen. Zoe gives 4 to Noah. How many snowmen does Zoe have left?



Task card 16 Winter Math

How many mittens are there?



Task card 17 Winter Math

How many snowmen are there?



Task card 18 Winter Math

How many snowmen are there?



Task card 19 Winter Math

Zoe has 1 snowflake. Ella brings 2 more. How many snowflakes are there now?



Task card 20 Winter Math

Omar has 6 snowflakes. Lily brings 2 more. How many snowflakes are there now?



Task card 21 Winter Math

Zoe has 9 mittens. Zoe gives 3 to Ben. How many mittens does Zoe have left?



Task card 22 Winter Math

Leo has 9 mittens. Leo gives 1 to Ben. How many mittens does Leo have left?



Task card 23 Winter Math

Ella has 3 mittens. Omar brings 4 more. How many mittens are there now?



Task card 24 Winter Math

How many snowflakes are there?



Winter Math Task Cards

Recording sheet · Kindergarten · Count the pictures and solve each story.

Name: _____ Date: _____

Scan to check your answers

1	2	3	4
5	6	7	8
9	10	11	12
13	14	15	16
17	18	19	20
21	22	23	24

Winter Math Task Cards: Answer Key

Kindergarten · Hard

The answers online

1. 1	**2.** 8	**3.** 8
4. 9	**5.** 5	**6.** 5
7. 6	**8.** 5	**9.** 3
10. 6	**11.** 9	**12.** 6
13. 7	**14.** 10	**15.** 1
16. 9	**17.** 3	**18.** 4
19. 3	**20.** 8	**21.** 6
22. 8	**23.** 7	**24.** 7