Winter Math · 1

Lily has 4 mittens. Lily gives 3 to Leo. How many mittens does Lily have left?



Winter Math · 2

Noah has 9 snowmen. Noah gives 1 to Sam. How many snowmen does Noah have left?



Winter Math · 3

Sam has 3 snowflakes. Ava brings 5 more. How many snowflakes are there now?



Winter Math · 4

How many snowflakes are there?



Winter Math · 5

Ella has 4 snowflakes. Sam brings 1 more. How many snowflakes are there now?



Winter Math · 6

Noah has 3 snowflakes. Leo brings 2 more. How many snowflakes are there now?



Winter Math · 7

How many snowmen are there?



Winter Math · 8

Zoe has 2 snowflakes. Ella brings 3 more. How many snowflakes are there now?



Winter Math · 2

ANSWER

8

Winter Math · 1

ANSWER

1

Winter Math · 4

ANSWER

9

Winter Math · 3

ANSWER

8

Winter Math · 6

ANSWER

5

Winter Math · 5

ANSWER

5

Winter Math · 8

ANSWER

5

Winter Math · 7

ANSWER

6

Winter Math · 9

Ben has 10 mittens. Ben gives 7 to Mia. How many mittens does Ben have left?



Winter Math · 10

Lily has 2 snowflakes. Ben brings 4 more. How many snowflakes are there now?



Winter Math · 11

Mia has 6 snowmen. Ava brings 3 more. How many snowmen are there now?



Winter Math · 12

How many mittens are there?



Winter Math · 13

How many mittens are there?



Winter Math · 14

Ava has 2 snowflakes. Leo brings 8 more. How many snowflakes are there now?



Winter Math · 15

Zoe has 5 snowmen. Zoe gives 4 to Noah. How many snowmen does Zoe have left?



Winter Math · 16

How many mittens are there?



Winter Math · 10

ANSWER

6

Winter Math · 9

ANSWER

3

Winter Math · 12

ANSWER

6

Winter Math · 11

ANSWER

9

Winter Math · 14

ANSWER

10

Winter Math · 13

ANSWER

7

Winter Math · 16

ANSWER

9

Winter Math · 15

ANSWER

1

Winter Math · 17

How many snowmen are there?



Winter Math · 18

How many snowmen are there?



Winter Math · 19

Zoe has 1 snowflake. Ella brings 2 more. How many snowflakes are there now?



Winter Math · 20

Omar has 6 snowflakes. Lily brings 2 more. How many snowflakes are there now?



Winter Math · 21

Zoe has 9 mittens. Zoe gives 3 to Ben. How many mittens does Zoe have left?



Winter Math · 22

Leo has 9 mittens. Leo gives 1 to Ben. How many mittens does Leo have left?



Winter Math · 23

Ella has 3 mittens. Omar brings 4 more. How many mittens are there now?



Winter Math · 24

How many snowflakes are there?



Winter Math · 18

ANSWER

4

Winter Math · 17

ANSWER

3

Winter Math · 20

ANSWER

8

Winter Math · 19

ANSWER

3

Winter Math · 22

ANSWER

8

Winter Math · 21

ANSWER

6

Winter Math · 24

ANSWER

7

Winter Math · 23

ANSWER

7