Task card 1 Valentine's Day Math

Sam has 5 hearts. Sam gives 1 to Omar. How many hearts does Sam have left?



Task card 2 Valentine's Day Math

How many roses are there?



Task card 3 Valentine's Day Math

Ava has 4 roses. Ben brings 4 more. How many roses are there now?



Task card 4 Valentine's Day Math

Leo has 2 roses. Zoe brings 5 more. How many roses are there now?



Task card 5 Valentine's Day Math

How many roses are there?



Task card 6 Valentine's Day Math

Ava has 7 hearts. Ava gives 1 to Sam. How many hearts does Ava have left?



Task card 7 Valentine's Day Math

How many cards are there?



Task card 8 Valentine's Day Math

Leo has 6 cards. Ava brings 1 more. How many cards are there now?



Task card 9 Valentine's Day Math

How many hearts are there?



Task card 10 Valentine's Day Math

Omar has 6 hearts. Omar gives 5 to Ben. How many hearts does Omar have left?



Task card 11 Valentine's Day Math

Lily has 4 hearts. Lily gives 2 to Zoe. How many hearts does Lily have left?



Task card 12 Valentine's Day Math

Mia has 2 cards. Lily brings 7 more. How many cards are there now?



Task card 13 Valentine's Day Math

Ben has 3 hearts. Lily brings 7 more. How many hearts are there now?



Task card 14 Valentine's Day Math

How many roses are there?



Task card 15 Valentine's Day Math

How many roses are there?



Task card 16 Valentine's Day Math

Leo has 4 cards. Ben brings 3 more. How many cards are there now?



Task card 17 Valentine's Day Math

Noah has 6 hearts. Ben brings 4 more. How many hearts are there now?



Task card 18 Valentine's Day Math

Ben has 2 roses. Sam brings 1 more. How many roses are there now?



Task card 19 Valentine's Day Math

Sam has 5 hearts. Ella brings 5 more. How many hearts are there now?



Task card 20 Valentine's Day Math

Omar has 9 roses. Omar gives 6 to Sam. How many roses does Omar have left?



Task card 21 Valentine's Day Math

Mia has 3 hearts. Mia gives 2 to Lily. How many hearts does Mia have left?



Task card 22 Valentine's Day Math

How many roses are there?



Task card 23 Valentine's Day Math

Omar has 5 roses. Ava brings 4 more. How many roses are there now?



Task card 24 Valentine's Day Math

Noah has 7 hearts. Noah gives 4 to Ben. How many hearts does Noah have left?



Valentine's Day Math Task Cards

Recording sheet · Kindergarten · Count the pictures and solve each story.

Name: _____ Date: _____

Scan to check your answers

1	2	3	4
5	6	7	8
9	10	11	12
13	14	15	16
17	18	19	20
21	22	23	24

Valentine's Day Math Task Cards: Answer Key

Kindergarten · Hard

The answers online

1. 4	**2.** 6	**3.** 8
4. 7	**5.** 4	**6.** 6
7. 4	**8.** 7	**9.** 9
10. 1	**11.** 2	**12.** 9
13. 10	**14.** 10	**15.** 8
16. 7	**17.** 10	**18.** 3
19. 10	**20.** 3	**21.** 1
22. 3	**23.** 9	**24.** 3