Valentine's Day Math · 1

How many roses are there?



Valentine's Day Math · 2

Noah has 3 cards. Noah gives 2 to Ava. How many cards does Noah have left?



Valentine's Day Math · 3

Sam has 1 rose. Omar brings 6 more. How many roses are there now?



Valentine's Day Math · 4

How many cards are there?



Valentine's Day Math · 5

How many roses are there?



Valentine's Day Math · 6

Mia has 6 hearts. Mia gives 5 to Sam. How many hearts does Mia have left?



Valentine's Day Math · 7

Noah has 1 card. Mia brings 7 more. How many cards are there now?



Valentine's Day Math · 8

Zoe has 3 roses. Lily brings 5 more. How many roses are there now?



Valentine's Day Math · 2

ANSWER

1

Valentine's Day Math · 1

ANSWER

3

Valentine's Day Math · 4

ANSWER

8

Valentine's Day Math · 3

ANSWER

7

Valentine's Day Math · 6

ANSWER

1

Valentine's Day Math · 5

ANSWER

6

Valentine's Day Math · 8

ANSWER

8

Valentine's Day Math · 7

ANSWER

8

Valentine's Day Math · 9

Noah has 5 cards. Noah gives 1 to Ava. How many cards does Noah have left?



Valentine's Day Math · 10

How many hearts are there?



Valentine's Day Math · 11

How many cards are there?



Valentine's Day Math · 12

Zoe has 8 roses. Zoe gives 3 to Noah. How many roses does Zoe have left?



Valentine's Day Math · 13

Mia has 4 hearts. Lily brings 3 more. How many hearts are there now?



Valentine's Day Math · 14

How many hearts are there?



Valentine's Day Math · 15

Ella has 2 roses. Ava brings 6 more. How many roses are there now?



Valentine's Day Math · 16

Lily has 4 hearts. Ella brings 5 more. How many hearts are there now?



Valentine's Day Math · 10

ANSWER

3

Valentine's Day Math · 9

ANSWER

4

Valentine's Day Math · 12

ANSWER

5

Valentine's Day Math · 11

ANSWER

5

Valentine's Day Math · 14

ANSWER

4

Valentine's Day Math · 13

ANSWER

7

Valentine's Day Math · 16

ANSWER

9

Valentine's Day Math · 15

ANSWER

8

Valentine's Day Math · 17

Ava has 3 hearts. Ava gives 1 to Sam. How many hearts does Ava have left?



Valentine's Day Math · 18

Zoe has 4 cards. Omar brings 4 more. How many cards are there now?



Valentine's Day Math · 19

Sam has 6 roses. Omar brings 1 more. How many roses are there now?



Valentine's Day Math · 20

How many roses are there?



Valentine's Day Math · 21

Ava has 4 hearts. Ava gives 1 to Noah. How many hearts does Ava have left?



Valentine's Day Math · 22

How many roses are there?



Valentine's Day Math · 23

Zoe has 4 roses. Ava brings 4 more. How many roses are there now?



Valentine's Day Math · 24

How many hearts are there?



Valentine's Day Math · 18

ANSWER

8

Valentine's Day Math · 17

ANSWER

2

Valentine's Day Math · 20

ANSWER

7

Valentine's Day Math · 19

ANSWER

7

Valentine's Day Math · 22

ANSWER

9

Valentine's Day Math · 21

ANSWER

3

Valentine's Day Math · 24

ANSWER

9

Valentine's Day Math · 23

ANSWER

8