Thanksgiving Math · 1

Ava has 7 apples. Ava gives 2 to Sam. How many apples does Ava have left?



Thanksgiving Math · 2

Ben has 2 leaves. Leo brings 7 more. How many leaves are there now?



Thanksgiving Math · 3

How many leaves are there?



Thanksgiving Math · 4

How many leaves are there?



Thanksgiving Math · 5

Ben has 10 leaves. Ben gives 2 to Sam. How many leaves does Ben have left?



Thanksgiving Math · 6

Leo has 1 leaf. Noah brings 7 more. How many leaves are there now?



Thanksgiving Math · 7

How many apples are there?



Thanksgiving Math · 8

Zoe has 6 leaves. Mia brings 2 more. How many leaves are there now?



Thanksgiving Math · 2

ANSWER

9

Thanksgiving Math · 1

ANSWER

5

Thanksgiving Math · 4

ANSWER

9

Thanksgiving Math · 3

ANSWER

10

Thanksgiving Math · 6

ANSWER

8

Thanksgiving Math · 5

ANSWER

8

Thanksgiving Math · 8

ANSWER

8

Thanksgiving Math · 7

ANSWER

10

Thanksgiving Math · 9

How many leaves are there?



Thanksgiving Math · 10

How many pies are there?



Thanksgiving Math · 11

Ben has 4 apples. Ben gives 3 to Noah. How many apples does Ben have left?



Thanksgiving Math · 12

Sam has 5 apples. Noah brings 1 more. How many apples are there now?



Thanksgiving Math · 13

Sam has 4 pies. Mia brings 1 more. How many pies are there now?



Thanksgiving Math · 14

Leo has 3 apples. Leo gives 2 to Omar. How many apples does Leo have left?



Thanksgiving Math · 15

Sam has 5 leaves. Noah brings 1 more. How many leaves are there now?



Thanksgiving Math · 16

How many apples are there?



Thanksgiving Math · 10

ANSWER

5

Thanksgiving Math · 9

ANSWER

7

Thanksgiving Math · 12

ANSWER

6

Thanksgiving Math · 11

ANSWER

1

Thanksgiving Math · 14

ANSWER

1

Thanksgiving Math · 13

ANSWER

5

Thanksgiving Math · 16

ANSWER

7

Thanksgiving Math · 15

ANSWER

6

Thanksgiving Math · 17

How many apples are there?



Thanksgiving Math · 18

How many apples are there?



Thanksgiving Math · 19

Ben has 6 pies. Noah brings 3 more. How many pies are there now?



Thanksgiving Math · 20

Ben has 5 apples. Zoe brings 5 more. How many apples are there now?



Thanksgiving Math · 21

Noah has 9 leaves. Noah gives 7 to Ben. How many leaves does Noah have left?



Thanksgiving Math · 22

Mia has 9 apples. Mia gives 8 to Leo. How many apples does Mia have left?



Thanksgiving Math · 23

Leo has 6 pies. Ava brings 2 more. How many pies are there now?



Thanksgiving Math · 24

Ava has 8 leaves. Ava gives 1 to Mia. How many leaves does Ava have left?



Thanksgiving Math · 18

ANSWER

9

Thanksgiving Math · 17

ANSWER

5

Thanksgiving Math · 20

ANSWER

10

Thanksgiving Math · 19

ANSWER

9

Thanksgiving Math · 22

ANSWER

1

Thanksgiving Math · 21

ANSWER

2

Thanksgiving Math · 24

ANSWER

7

Thanksgiving Math · 23

ANSWER

8