Thanksgiving Math · 1

How many apples are there?



Thanksgiving Math · 2

Ella has 4 pies. Mia brings 1 more. How many pies are there now?



Thanksgiving Math · 3

How many leaves are there?



Thanksgiving Math · 4

Leo has 7 pies. Leo gives 3 to Ella. How many pies does Leo have left?



Thanksgiving Math · 5

How many pies are there?



Thanksgiving Math · 6

Ben has 5 pies. Omar brings 2 more. How many pies are there now?



Thanksgiving Math · 7

Ben has 4 leaves. Omar brings 4 more. How many leaves are there now?



Thanksgiving Math · 8

Ava has 5 pies. Ava gives 2 to Ben. How many pies does Ava have left?



Thanksgiving Math · 2

ANSWER

5

Thanksgiving Math · 1

ANSWER

8

Thanksgiving Math · 4

ANSWER

4

Thanksgiving Math · 3

ANSWER

8

Thanksgiving Math · 6

ANSWER

7

Thanksgiving Math · 5

ANSWER

6

Thanksgiving Math · 8

ANSWER

3

Thanksgiving Math · 7

ANSWER

8

Thanksgiving Math · 9

How many leaves are there?



Thanksgiving Math · 10

Ben has 5 apples. Ben gives 1 to Sam. How many apples does Ben have left?



Thanksgiving Math · 11

Ben has 3 leaves. Zoe brings 1 more. How many leaves are there now?



Thanksgiving Math · 12

Ben has 3 apples. Omar brings 6 more. How many apples are there now?



Thanksgiving Math · 13

How many pies are there?



Thanksgiving Math · 14

Sam has 7 leaves. Sam gives 6 to Mia. How many leaves does Sam have left?



Thanksgiving Math · 15

Leo has 6 apples. Mia brings 2 more. How many apples are there now?



Thanksgiving Math · 16

Lily has 3 apples. Ava brings 3 more. How many apples are there now?



Thanksgiving Math · 10

ANSWER

4

Thanksgiving Math · 9

ANSWER

7

Thanksgiving Math · 12

ANSWER

9

Thanksgiving Math · 11

ANSWER

4

Thanksgiving Math · 14

ANSWER

1

Thanksgiving Math · 13

ANSWER

9

Thanksgiving Math · 16

ANSWER

6

Thanksgiving Math · 15

ANSWER

8

Thanksgiving Math · 17

Ben has 1 pie. Noah brings 6 more. How many pies are there now?



Thanksgiving Math · 18

Sam has 6 pies. Zoe brings 2 more. How many pies are there now?



Thanksgiving Math · 19

How many apples are there?



Thanksgiving Math · 20

Ben has 5 leaves. Ben gives 4 to Leo. How many leaves does Ben have left?



Thanksgiving Math · 21

How many pies are there?



Thanksgiving Math · 22

Noah has 3 apples. Noah gives 2 to Ben. How many apples does Noah have left?



Thanksgiving Math · 23

Omar has 4 leaves. Sam brings 4 more. How many leaves are there now?



Thanksgiving Math · 24

Lily has 5 pies. Ben brings 2 more. How many pies are there now?



Thanksgiving Math · 18

ANSWER

8

Thanksgiving Math · 17

ANSWER

7

Thanksgiving Math · 20

ANSWER

1

Thanksgiving Math · 19

ANSWER

6

Thanksgiving Math · 22

ANSWER

1

Thanksgiving Math · 21

ANSWER

5

Thanksgiving Math · 24

ANSWER

7

Thanksgiving Math · 23

ANSWER

8