Telling Time to the Hour · 1

The clock shows 4 o'clock. What time will it be 2 hours later? Write the number: ___ o'clock.



Telling Time to the Hour · 2

The clock shows 11 o'clock. What time was it 1 hour ago? Write the number: ___ o'clock.



Telling Time to the Hour · 3

Which clock shows 8:00? Write A, B, or C.



A B C

Telling Time to the Hour · 4

What time does the clock show? Write it like 3:00.



Telling Time to the Hour · 5

Omar goes to school at 8 o'clock. Which clock shows 8 o'clock? Write A or B.



A B

Telling Time to the Hour · 6

The clock shows 5 o'clock. What time will it be 1 hour later? Write the number: ___ o'clock.



Telling Time to the Hour · 7

The clock shows 10 o'clock. What time was it 2 hours ago? Write the number: ___ o'clock.



Telling Time to the Hour · 8

Which clock shows 1:00? Write A, B, or C.



A B C

Telling Time to the Hour · 2

ANSWER

10

Telling Time to the Hour · 1

ANSWER

6

Telling Time to the Hour · 4

ANSWER

9:00

Telling Time to the Hour · 3

ANSWER

C

Telling Time to the Hour · 6

ANSWER

6

Telling Time to the Hour · 5

ANSWER

A

Telling Time to the Hour · 8

ANSWER

A

Telling Time to the Hour · 7

ANSWER

8

Telling Time to the Hour · 9

How many hours is it from 3 o'clock to 5 o'clock?



Telling Time to the Hour · 10

The clock shows 3 o'clock. What time will it be 2 hours later? Write the number: ___ o'clock.



Telling Time to the Hour · 11

The clock shows 4 o'clock. What time was it 2 hours ago? Write the number: ___ o'clock.



Telling Time to the Hour · 12

Which clock shows 10:00? Write A, B, or C.



A B C

Telling Time to the Hour · 13

What time does the clock show? Write it like 3:00.



Telling Time to the Hour · 14

Zoe eats dinner at 6 o'clock. Which clock shows 6 o'clock? Write A or B.



A B

Telling Time to the Hour · 15

How many hours is it from 8 o'clock to 10 o'clock?



Telling Time to the Hour · 16

The clock shows 11 o'clock. What time will it be 1 hour later? Write the number: ___ o'clock.



Telling Time to the Hour · 10

ANSWER

5

Telling Time to the Hour · 9

ANSWER

2

Telling Time to the Hour · 12

ANSWER

B

Telling Time to the Hour · 11

ANSWER

2

Telling Time to the Hour · 14

ANSWER

A

Telling Time to the Hour · 13

ANSWER

5:00

Telling Time to the Hour · 16

ANSWER

12

Telling Time to the Hour · 15

ANSWER

2

Telling Time to the Hour · 17

The clock shows 12 o'clock. What time will it be 2 hours later? Write the number: ___ o'clock.



Telling Time to the Hour · 18

The clock shows 12 o'clock. What time was it 1 hour ago? Write the number: ___ o'clock.



Telling Time to the Hour · 19

Which clock shows 8:00? Write A, B, or C.



A B C

Telling Time to the Hour · 20

What time does the clock show? Write it like 3:00.



Telling Time to the Hour · 21

Ava eats breakfast at 7 o'clock. Which clock shows 7 o'clock? Write A or B.



A B

Telling Time to the Hour · 22

The clock shows 7 o'clock. What time will it be 1 hour later? Write the number: ___ o'clock.



Telling Time to the Hour · 23

The clock shows 9 o'clock. What time was it 2 hours ago? Write the number: ___ o'clock.



Telling Time to the Hour · 24

Which clock shows 6:00? Write A, B, or C.



A B C

Telling Time to the Hour · 18

ANSWER

11

Telling Time to the Hour · 17

ANSWER

2

Telling Time to the Hour · 20

ANSWER

10:00

Telling Time to the Hour · 19

ANSWER

A

Telling Time to the Hour · 22

ANSWER

8

Telling Time to the Hour · 21

ANSWER

A

Telling Time to the Hour · 24

ANSWER

C

Telling Time to the Hour · 23

ANSWER

7