Telling Time to the Hour · 1

What time does the clock show?

Write it like 3:00.



Telling Time to the Hour · 2

What time is it? Write the number:

___ o'clock.



Telling Time to the Hour · 3

Which clock shows 1:00?

Write A or B.



A B

Telling Time to the Hour · 4

Sam eats dinner at 6 o'clock. Which clock shows 6 o'clock? Write A or B.



A B

Telling Time to the Hour · 5

What time does the clock show?

Write it like 3:00.



Telling Time to the Hour · 6

Which clock shows 2:00?

Write A or B.



A B

Telling Time to the Hour · 7

What time is it? Write the number:

___ o'clock.



Telling Time to the Hour · 8

What time does the clock show?

Write it like 3:00.



Telling Time to the Hour · 2

ANSWER

7

Telling Time to the Hour · 1

ANSWER

2:00

Telling Time to the Hour · 4

ANSWER

B

Telling Time to the Hour · 3

ANSWER

A

Telling Time to the Hour · 6

ANSWER

A

Telling Time to the Hour · 5

ANSWER

12:00

Telling Time to the Hour · 8

ANSWER

11:00

Telling Time to the Hour · 7

ANSWER

3

Telling Time to the Hour · 9

What time is it? Write the number: ___ o'clock.



Telling Time to the Hour · 10

What time does the clock show? Write it like 3:00.



Telling Time to the Hour · 11

The clock shows 5 o'clock. What time will it be 1 hour later? Write the number: ___ o'clock.



Telling Time to the Hour · 12

Which clock shows 5:00? Write A or B.



A B

Telling Time to the Hour · 13

Sam eats breakfast at 7 o'clock. Which clock shows 7 o'clock? Write A or B.



A B

Telling Time to the Hour · 14

The clock shows 2 o'clock. What time will it be 1 hour later? Write the number: ___ o'clock.



Telling Time to the Hour · 15

It is 11 o'clock. What number does the long hand point to?



Telling Time to the Hour · 16

What time does the clock show? Write it like 3:00.



Telling Time to the Hour · 10

ANSWER

7:00

Telling Time to the Hour · 9

ANSWER

6

Telling Time to the Hour · 12

ANSWER

B

Telling Time to the Hour · 11

ANSWER

6

Telling Time to the Hour · 14

ANSWER

3

Telling Time to the Hour · 13

ANSWER

B

Telling Time to the Hour · 16

ANSWER

9:00

Telling Time to the Hour · 15

ANSWER

12

Telling Time to the Hour · 17

What time does the clock show? Write it like 3:00.



Telling Time to the Hour · 18

The clock shows 9 o'clock. What time will it be 1 hour later? Write the number: ___ o'clock.



Telling Time to the Hour · 19

The clock shows 11 o'clock. What time was it 1 hour ago? Write the number: ___ o'clock.



Telling Time to the Hour · 20

Which clock shows 11:00? Write A, B, or C.



A B C

Telling Time to the Hour · 21

Lily eats breakfast at 7 o'clock. Which clock shows 7 o'clock? Write A or B.



A B

Telling Time to the Hour · 22

What time is it? Write the number: ___ o'clock.



Telling Time to the Hour · 23

The clock shows 6 o'clock. What time will it be 1 hour later? Write the number: ___ o'clock.



Telling Time to the Hour · 24

The clock shows 5 o'clock. What time was it 1 hour ago? Write the number: ___ o'clock.



Telling Time to the Hour · 18

ANSWER

10

Telling Time to the Hour · 17

ANSWER

1:00

Telling Time to the Hour · 20

ANSWER

C

Telling Time to the Hour · 19

ANSWER

10

Telling Time to the Hour · 22

ANSWER

2

Telling Time to the Hour · 21

ANSWER

A

Telling Time to the Hour · 24

ANSWER

4

Telling Time to the Hour · 23

ANSWER

7