Telling Time to the Hour · 1

What time is it? Write the number:

___ o'clock.



Telling Time to the Hour · 2

What time is it? Write the number:

___ o'clock.



Telling Time to the Hour · 3

What time is it? Write the number:

___ o'clock.



Telling Time to the Hour · 4

What time is it? Write the number:

___ o'clock.



Telling Time to the Hour · 5

What time is it? Write the number:

___ o'clock.



Telling Time to the Hour · 6

What time is it? Write the number:

___ o'clock.



Telling Time to the Hour · 7

What time is it? Write the number:

___ o'clock.



Telling Time to the Hour · 8

What time is it? Write the number:

___ o'clock.



Telling Time to the Hour · 2

ANSWER

7

Telling Time to the Hour · 1

ANSWER

4

Telling Time to the Hour · 4

ANSWER

8

Telling Time to the Hour · 3

ANSWER

3

Telling Time to the Hour · 6

ANSWER

10

Telling Time to the Hour · 5

ANSWER

9

Telling Time to the Hour · 8

ANSWER

1

Telling Time to the Hour · 7

ANSWER

5

Telling Time to the Hour · 9

It is 3 o'clock. What number does the long hand point to?



Telling Time to the Hour · 10

What time is it? Write the number:

___ o'clock.



Telling Time to the Hour · 11

What time is it? Write the number:

___ o'clock.



Telling Time to the Hour · 12

Which clock shows 6:00?

Write A or B.



A B

Telling Time to the Hour · 13

It is 6 o'clock. What number does the long hand point to?



Telling Time to the Hour · 14

Which clock shows 9:00?

Write A or B.



A B

Telling Time to the Hour · 15

What time is it? Write the number:

___ o'clock.



Telling Time to the Hour · 16

Which clock shows 12:00?

Write A or B.



A B

Telling Time to the Hour · 10

ANSWER

11

Telling Time to the Hour · 9

ANSWER

12

Telling Time to the Hour · 12

ANSWER

B

Telling Time to the Hour · 11

ANSWER

12

Telling Time to the Hour · 14

ANSWER

B

Telling Time to the Hour · 13

ANSWER

12

Telling Time to the Hour · 16

ANSWER

B

Telling Time to the Hour · 15

ANSWER

2

Telling Time to the Hour · 17

What time is it? Write the number:

___ o'clock.



Telling Time to the Hour · 18

Which clock shows 2:00?

Write A or B.



A B

Telling Time to the Hour · 19

It is 5 o'clock. What number does the long hand point to?



Telling Time to the Hour · 20

Which clock shows 4:00?

Write A or B.



A B

Telling Time to the Hour · 21

Which clock shows 7:00?

Write A or B.



A B

Telling Time to the Hour · 22

Which clock shows 6:00?

Write A or B.



A B

Telling Time to the Hour · 23

It is 7 o'clock. What number does the long hand point to?



Telling Time to the Hour · 24

Which clock shows 7:00?

Write A or B.



A B

Telling Time to the Hour · 18

ANSWER

A

Telling Time to the Hour · 17

ANSWER

6

Telling Time to the Hour · 20

ANSWER

A

Telling Time to the Hour · 19

ANSWER

12

Telling Time to the Hour · 22

ANSWER

A

Telling Time to the Hour · 21

ANSWER

A

Telling Time to the Hour · 24

ANSWER

A

Telling Time to the Hour · 23

ANSWER

12