Summer Math · 1

Omar has 2 fish. Ava brings 3 more. How many fish are there now?



Summer Math · 2

Ben has 1 fish. Ella brings 1 more. How many fish are there now?



Summer Math · 3

How many seashells are there?



Summer Math · 4

Ava has 10 fish. Ava gives 8 to Ella. How many fish does Ava have left?



Summer Math · 5

Lily has 2 ice cream cones. Ella brings 8 more. How many ice cream cones are there now?



Summer Math · 6

How many fish are there?



Summer Math · 7

How many ice cream cones are there?



Summer Math · 8

Lily has 7 ice cream cones. Lily gives 5 to Noah. How many ice cream cones does Lily have left?



Summer Math · 2

ANSWER

2

Summer Math · 1

ANSWER

5

Summer Math · 4

ANSWER

2

Summer Math · 3

ANSWER

4

Summer Math · 6

ANSWER

6

Summer Math · 5

ANSWER

10

Summer Math · 8

ANSWER

2

Summer Math · 7

ANSWER

4

Summer Math · 9

How many ice cream cones are there?



Summer Math · 10

Mia has 5 ice cream cones. Leo brings 1 more. How many ice cream cones are there now?



Summer Math · 11

Ella has 9 fish. Ella gives 7 to Ben. How many fish does Ella have left?



Summer Math · 12

Lily has 4 fish. Lily gives 1 to Zoe. How many fish does Lily have left?



Summer Math · 13

How many fish are there?



Summer Math · 14

How many seashells are there?



Summer Math · 15

Ben has 6 seashells. Mia brings 1 more. How many seashells are there now?



Summer Math · 16

Lily has 6 ice cream cones. Noah brings 4 more. How many ice cream cones are there now?



Summer Math · 10

ANSWER

6

Summer Math · 9

ANSWER

9

Summer Math · 12

ANSWER

3

Summer Math · 11

ANSWER

2

Summer Math · 14

ANSWER

10

Summer Math · 13

ANSWER

7

Summer Math · 16

ANSWER

10

Summer Math · 15

ANSWER

7

Summer Math · 17

How many seashells are there?



Summer Math · 18

How many seashells are there?



Summer Math · 19

Noah has 5 fish. Omar brings 3 more. How many fish are there now?



Summer Math · 20

Ben has 8 fish. Ben gives 6 to Ella. How many fish does Ben have left?



Summer Math · 21

Ava has 4 ice cream cones. Ella brings 6 more. How many ice cream cones are there now?



Summer Math · 22

Ella has 7 fish. Ella gives 5 to Lily. How many fish does Ella have left?



Summer Math · 23

Leo has 5 ice cream cones. Mia brings 4 more. How many ice cream cones are there now?



Summer Math · 24

Ella has 1 seashell. Ben brings 8 more. How many seashells are there now?



Summer Math · 18

ANSWER

8

Summer Math · 17

ANSWER

5

Summer Math · 20

ANSWER

2

Summer Math · 19

ANSWER

8

Summer Math · 22

ANSWER

2

Summer Math · 21

ANSWER

10

Summer Math · 24

ANSWER

9

Summer Math · 23

ANSWER

9