Summer Math · 1

Leo has 5 ice cream cones. Leo gives 1 to Ben. How many ice cream cones does Leo have left?



Summer Math · 2

How many fish are there?



Summer Math · 3

How many ice cream cones are there?



Summer Math · 4

Ella has 5 fish. Ella gives 1 to Omar. How many fish does Ella have left?



Summer Math · 5

Ben has 2 fish. Mia brings 1 more. How many fish are there now?



Summer Math · 6

Leo has 2 ice cream cones. Ben brings 1 more. How many ice cream cones are there now?



Summer Math · 7

Lily has 1 seashell. Ava brings 3 more. How many seashells are there now?



Summer Math · 8

How many ice cream cones are there?



Summer Math · 2

ANSWER

3

Summer Math · 1

ANSWER

4

Summer Math · 4

ANSWER

4

Summer Math · 3

ANSWER

5

Summer Math · 6

ANSWER

3

Summer Math · 5

ANSWER

3

Summer Math · 8

ANSWER

4

Summer Math · 7

ANSWER

4

Summer Math · 9

Mia has 6 ice cream cones. Mia gives 2 to Ava. How many ice cream cones does Mia have left?



Summer Math · 10

Noah has 6 ice cream cones. Noah gives 4 to Lily. How many ice cream cones does Noah have left?



Summer Math · 11

Ella has 2 ice cream cones. Lily brings 3 more. How many ice cream cones are there now?



Summer Math · 12

How many seashells are there?



Summer Math · 13

How many ice cream cones are there?



Summer Math · 14

Ben has 1 fish. Mia brings 2 more. How many fish are there now?



Summer Math · 15

Mia has 2 fish. Ella brings 1 more. How many fish are there now?



Summer Math · 16

Mia has 5 fish. Ella brings 2 more. How many fish are there now?



Summer Math · 10

ANSWER

2

Summer Math · 9

ANSWER

4

Summer Math · 12

ANSWER

3

Summer Math · 11

ANSWER

5

Summer Math · 14

ANSWER

3

Summer Math · 13

ANSWER

6

Summer Math · 16

ANSWER

7

Summer Math · 15

ANSWER

3

Summer Math · 17

How many seashells are there?



Summer Math · 18

Ella has 5 fish. Ben brings 1 more. How many fish are there now?



Summer Math · 19

Ella has 2 fish. Ben brings 3 more. How many fish are there now?



Summer Math · 20

Leo has 3 seashells. Leo gives 2 to Ava. How many seashells does Leo have left?



Summer Math · 21

How many fish are there?



Summer Math · 22

Zoe has 2 fish. Ben brings 3 more. How many fish are there now?



Summer Math · 23

Omar has 7 fish. Omar gives 5 to Leo. How many fish does Omar have left?



Summer Math · 24

Noah has 1 seashell. Omar brings 1 more. How many seashells are there now?



Summer Math · 18

ANSWER

6

Summer Math · 17

ANSWER

6

Summer Math · 20

ANSWER

1

Summer Math · 19

ANSWER

5

Summer Math · 22

ANSWER

5

Summer Math · 21

ANSWER

7

Summer Math · 24

ANSWER

2

Summer Math · 23

ANSWER

2