Task card 1 St. Patrick's Day Math

How many shamrocks are there?



Task card 2 St. Patrick's Day Math

Mia has 4 green hats. Omar brings 3 more. How many green hats are there now?



Task card 3 St. Patrick's Day Math

How many gold coins are there?



Task card 4 St. Patrick's Day Math

Ella has 6 green hats. Omar brings 2 more. How many green hats are there now?



Task card 5 St. Patrick's Day Math

Ava has 3 green hats. Ava gives 2 to Leo. How many green hats does Ava have left?



Task card 6 St. Patrick's Day Math

Omar has 4 green hats. Mia brings 1 more. How many green hats are there now?



Task card 7 St. Patrick's Day Math

How many gold coins are there?



Task card 8 St. Patrick's Day Math

Sam has 6 green hats. Sam gives 1 to Noah. How many green hats does Sam have left?



Task card 9 St. Patrick's Day Math

Noah has 1 shamrock. Mia brings 4 more. How many shamrocks are there now?



Task card 10 St. Patrick's Day Math

How many green hats are there?



Task card 11 St. Patrick's Day Math

Noah has 6 shamrocks. Ava brings 3 more. How many shamrocks are there now?



Task card 12 St. Patrick's Day Math

Lily has 4 shamrocks. Lily gives 1 to Ella. How many shamrocks does Lily have left?



Task card 13 St. Patrick's Day Math

Ava has 4 gold coins. Leo brings 1 more. How many gold coins are there now?



Task card 14 St. Patrick's Day Math

Sam has 8 shamrocks. Sam gives 4 to Ben. How many shamrocks does Sam have left?



Task card 15 St. Patrick's Day Math

Omar has 5 green hats. Leo brings 3 more. How many green hats are there now?



Task card 16 St. Patrick's Day Math

How many shamrocks are there?



Task card 17 St. Patrick's Day Math

Ava has 8 green hats. Ava gives 4 to Ben. How many green hats does Ava have left?



Task card 18 St. Patrick's Day Math

Ava has 6 gold coins. Ava gives 5 to Lily. How many gold coins does Ava have left?



Task card 19 St. Patrick's Day Math

How many gold coins are there?



Task card 20 St. Patrick's Day Math

Leo has 6 green hats. Lily brings 2 more. How many green hats are there now?



Task card 21 St. Patrick's Day Math

Mia has 4 gold coins. Omar brings 3 more. How many gold coins are there now?



Task card 22 St. Patrick's Day Math

Sam has 3 gold coins. Sam gives 1 to Mia. How many gold coins does Sam have left?



Task card 23 St. Patrick's Day Math

Mia has 5 gold coins. Sam brings 3 more. How many gold coins are there now?



Task card 24 St. Patrick's Day Math

Mia has 4 gold coins. Mia gives 1 to Ava. How many gold coins does Mia have left?



St. Patrick's Day Math Task Cards

Recording sheet · Kindergarten · Count the pictures and solve each story.

Name: _____ Date: _____

Scan to check your answers

1	2	3	4
5	6	7	8
9	10	11	12
13	14	15	16
17	18	19	20
21	22	23	24

St. Patrick's Day Math Task Cards: Answer Key

Kindergarten · Medium

The answers online

1. 5	**2.** 7	**3.** 8
4. 8	**5.** 1	**6.** 5
7. 5	**8.** 5	**9.** 5
10. 7	**11.** 9	**12.** 3
13. 5	**14.** 4	**15.** 8
16. 10	**17.** 4	**18.** 1
19. 10	**20.** 8	**21.** 7
22. 2	**23.** 8	**24.** 3