Task card 1 St. Patrick's Day Math

Ava has 3 green hats. Ella brings 3 more. How many green hats are there now?



Task card 2 St. Patrick's Day Math

How many green hats are there?



Task card 3 St. Patrick's Day Math

How many gold coins are there?



Task card 4 St. Patrick's Day Math

Ava has 5 green hats. Ava gives 4 to Noah. How many green hats does Ava have left?



Task card 5 St. Patrick's Day Math

Ava has 10 gold coins. Ava gives 3 to Sam. How many gold coins does Ava have left?



Task card 6 St. Patrick's Day Math

Sam has 2 green hats. Ben brings 8 more. How many green hats are there now?



Task card 7 St. Patrick's Day Math

How many green hats are there?



Task card 8 St. Patrick's Day Math

Ava has 4 green hats. Sam brings 2 more. How many green hats are there now?



Task card 9 St. Patrick's Day Math

How many gold coins are there?



Task card 10 St. Patrick's Day Math

How many shamrocks are there?



Task card 11 St. Patrick's Day Math

How many gold coins are there?



Task card 12 St. Patrick's Day Math

Leo has 1 gold coin. Lily brings 1 more. How many gold coins are there now?



Task card 13 St. Patrick's Day Math

Lily has 9 gold coins. Lily gives 4 to Ben. How many gold coins does Lily have left?



Task card 14 St. Patrick's Day Math

Ava has 4 green hats. Mia brings 2 more. How many green hats are there now?



Task card 15 St. Patrick's Day Math

Omar has 4 green hats. Mia brings 6 more. How many green hats are there now?



Task card 16 St. Patrick's Day Math

Sam has 7 green hats. Sam gives 1 to Omar. How many green hats does Sam have left?



Task card 17 St. Patrick's Day Math

Ben has 4 gold coins. Noah brings 2 more. How many gold coins are there now?



Task card 18 St. Patrick's Day Math

Mia has 4 green hats. Noah brings 5 more. How many green hats are there now?



Task card 19 St. Patrick's Day Math

Sam has 6 green hats. Sam gives 4 to Mia. How many green hats does Sam have left?



Task card 20 St. Patrick's Day Math

How many green hats are there?



Task card 21 St. Patrick's Day Math

Ben has 4 gold coins. Leo brings 3 more. How many gold coins are there now?



Task card 22 St. Patrick's Day Math

Ella has 4 gold coins. Ella gives 2 to Lily. How many gold coins does Ella have left?



Task card 23 St. Patrick's Day Math

How many gold coins are there?



Task card 24 St. Patrick's Day Math

How many green hats are there?



St. Patrick's Day Math Task Cards

Recording sheet · Kindergarten · Count the pictures and solve each story.

Name: _____ Date: _____

Scan to check your answers

1	2	3	4
5	6	7	8
9	10	11	12
13	14	15	16
17	18	19	20
21	22	23	24

St. Patrick's Day Math Task Cards: Answer Key

Kindergarten · Hard

The answers online

1. 6	**2.** 4	**3.** 8
4. 1	**5.** 7	**6.** 10
7. 9	**8.** 6	**9.** 10
10. 4	**11.** 3	**12.** 2
13. 5	**14.** 6	**15.** 10
16. 6	**17.** 6	**18.** 9
19. 2	**20.** 6	**21.** 7
22. 2	**23.** 7	**24.** 10