Task card 1 St. Patrick's Day Math

Ella has 2 shamrocks. Sam brings 1 more. How many shamrocks are there now?



Task card 2 St. Patrick's Day Math

Leo has 4 shamrocks. Leo gives 1 to Ben. How many shamrocks does Leo have left?



Task card 3 St. Patrick's Day Math

Noah has 3 green hats. Ava brings 1 more. How many green hats are there now?



Task card 4 St. Patrick's Day Math

How many gold coins are there?



Task card 5 St. Patrick's Day Math

How many green hats are there?



Task card 6 St. Patrick's Day Math

Leo has 1 gold coin. Ella brings 2 more. How many gold coins are there now?



Task card 7 St. Patrick's Day Math

Leo has 5 shamrocks. Leo gives 3 to Sam. How many shamrocks does Leo have left?



Task card 8 St. Patrick's Day Math

Omar has 2 green hats. Ben brings 1 more. How many green hats are there now?



Task card 9 St. Patrick's Day Math

How many gold coins are there?



Task card 10 St. Patrick's Day Math

Ben has 4 shamrocks. Lily brings 2 more. How many shamrocks are there now?



Task card 11 St. Patrick's Day Math

Leo has 4 gold coins. Leo gives 2 to Sam. How many gold coins does Leo have left?



Task card 12 St. Patrick's Day Math

Sam has 4 gold coins. Ella brings 2 more. How many gold coins are there now?



Task card 13 St. Patrick's Day Math

Mia has 3 green hats. Mia gives 2 to Leo. How many green hats does Mia have left?



Task card 14 St. Patrick's Day Math

How many shamrocks are there?



Task card 15 St. Patrick's Day Math

Mia has 3 gold coins. Leo brings 3 more. How many gold coins are there now?



Task card 16 St. Patrick's Day Math

Mia has 4 green hats. Mia gives 2 to Zoe. How many green hats does Mia have left?



Task card 17 St. Patrick's Day Math

Omar has 3 shamrocks. Omar gives 2 to Leo. How many shamrocks does Omar have left?



Task card 18 St. Patrick's Day Math

Ella has 4 gold coins. Lily brings 2 more. How many gold coins are there now?



Task card 19 St. Patrick's Day Math

Zoe has 5 gold coins. Leo brings 1 more. How many gold coins are there now?



Task card 20 St. Patrick's Day Math

Mia has 5 gold coins. Ben brings 2 more. How many gold coins are there now?



Task card 21 St. Patrick's Day Math

How many gold coins are there?



Task card 22 St. Patrick's Day Math

How many green hats are there?



Task card 23 St. Patrick's Day Math

How many green hats are there?



Task card 24 St. Patrick's Day Math

Zoe has 5 green hats. Zoe gives 4 to Ella. How many green hats does Zoe have left?



St. Patrick's Day Math Task Cards

Recording sheet · Kindergarten · Count the pictures and solve each story.

Name: _____ Date: _____

Scan to check your answers

1	2	3	4
5	6	7	8
9	10	11	12
13	14	15	16
17	18	19	20
21	22	23	24

St. Patrick's Day Math Task Cards: Answer Key

Kindergarten · Easy

The answers online

1. 3	**2.** 3	**3.** 4
4. 4	**5.** 5	**6.** 3
7. 2	**8.** 3	**9.** 6
10. 6	**11.** 2	**12.** 6
13. 1	**14.** 4	**15.** 6
16. 2	**17.** 1	**18.** 6
19. 6	**20.** 7	**21.** 7
22. 6	**23.** 4	**24.** 1