St. Patrick's Day Math · 1

Ava has 3 green hats. Ella brings 3 more. How many green hats are there now?



St. Patrick's Day Math · 2

How many green hats are there?



St. Patrick's Day Math · 3

How many gold coins are there?



St. Patrick's Day Math · 4

Ava has 5 green hats. Ava gives 4 to Noah. How many green hats does Ava have left?



St. Patrick's Day Math · 5

Ava has 10 gold coins. Ava gives 3 to Sam. How many gold coins does Ava have left?



St. Patrick's Day Math · 6

Sam has 2 green hats. Ben brings 8 more. How many green hats are there now?



St. Patrick's Day Math · 7

How many green hats are there?



St. Patrick's Day Math · 8

Ava has 4 green hats. Sam brings 2 more. How many green hats are there now?



St. Patrick's Day Math · 2

ANSWER

4

St. Patrick's Day Math · 1

ANSWER

6

St. Patrick's Day Math · 4

ANSWER

1

St. Patrick's Day Math · 3

ANSWER

8

St. Patrick's Day Math · 6

ANSWER

10

St. Patrick's Day Math · 5

ANSWER

7

St. Patrick's Day Math · 8

ANSWER

6

St. Patrick's Day Math · 7

ANSWER

9

St. Patrick's Day Math · 9

How many gold coins are there?



St. Patrick's Day Math · 10

How many shamrocks are there?



St. Patrick's Day Math · 11

How many gold coins are there?



St. Patrick's Day Math · 12

Leo has 1 gold coin. Lily brings 1 more. How many gold coins are there now?



St. Patrick's Day Math · 13

Lily has 9 gold coins. Lily gives 4 to Ben. How many gold coins does Lily have left?



St. Patrick's Day Math · 14

Ava has 4 green hats. Mia brings 2 more. How many green hats are there now?



St. Patrick's Day Math · 15

Omar has 4 green hats. Mia brings 6 more. How many green hats are there now?



St. Patrick's Day Math · 16

Sam has 7 green hats. Sam gives 1 to Omar. How many green hats does Sam have left?



St. Patrick's Day Math · 10

ANSWER

4

St. Patrick's Day Math · 9

ANSWER

10

St. Patrick's Day Math · 12

ANSWER

2

St. Patrick's Day Math · 11

ANSWER

3

St. Patrick's Day Math · 14

ANSWER

6

St. Patrick's Day Math · 13

ANSWER

5

St. Patrick's Day Math · 16

ANSWER

6

St. Patrick's Day Math · 15

ANSWER

10

St. Patrick's Day Math · 17

Ben has 4 gold coins. Noah brings 2 more. How many gold coins are there now?



St. Patrick's Day Math · 18

Mia has 4 green hats. Noah brings 5 more. How many green hats are there now?



St. Patrick's Day Math · 19

Sam has 6 green hats. Sam gives 4 to Mia. How many green hats does Sam have left?



St. Patrick's Day Math · 20

How many green hats are there?



St. Patrick's Day Math · 21

Ben has 4 gold coins. Leo brings 3 more. How many gold coins are there now?



St. Patrick's Day Math · 22

Ella has 4 gold coins. Ella gives 2 to Lily. How many gold coins does Ella have left?



St. Patrick's Day Math · 23

How many gold coins are there?



St. Patrick's Day Math · 24

How many green hats are there?



St. Patrick's Day Math · 18

ANSWER

9

St. Patrick's Day Math · 17

ANSWER

6

St. Patrick's Day Math · 20

ANSWER

6

St. Patrick's Day Math · 19

ANSWER

2

St. Patrick's Day Math · 22

ANSWER

2

St. Patrick's Day Math · 21

ANSWER

7

St. Patrick's Day Math · 24

ANSWER

10

St. Patrick's Day Math · 23

ANSWER

7