St. Patrick's Day Math · 1

How many shamrocks are there?



St. Patrick's Day Math · 2

Mia has 4 green hats. Omar brings 3 more. How many green hats are there now?



St. Patrick's Day Math · 3

How many gold coins are there?



St. Patrick's Day Math · 4

Ella has 6 green hats. Omar brings 2 more. How many green hats are there now?



St. Patrick's Day Math · 5

Ava has 3 green hats. Ava gives 2 to Leo. How many green hats does Ava have left?



St. Patrick's Day Math · 6

Omar has 4 green hats. Mia brings 1 more. How many green hats are there now?



St. Patrick's Day Math · 7

How many gold coins are there?



St. Patrick's Day Math · 8

Sam has 6 green hats. Sam gives 1 to Noah. How many green hats does Sam have left?



St. Patrick's Day Math · 2

ANSWER

7

St. Patrick's Day Math · 1

ANSWER

5

St. Patrick's Day Math · 4

ANSWER

8

St. Patrick's Day Math · 3

ANSWER

8

St. Patrick's Day Math · 6

ANSWER

5

St. Patrick's Day Math · 5

ANSWER

1

St. Patrick's Day Math · 8

ANSWER

5

St. Patrick's Day Math · 7

ANSWER

5

St. Patrick's Day Math · 9

Noah has 1 shamrock. Mia brings 4 more. How many shamrocks are there now?



St. Patrick's Day Math · 10

How many green hats are there?



St. Patrick's Day Math · 11

Noah has 6 shamrocks. Ava brings 3 more. How many shamrocks are there now?



St. Patrick's Day Math · 12

Lily has 4 shamrocks. Lily gives 1 to Ella. How many shamrocks does Lily have left?



St. Patrick's Day Math · 13

Ava has 4 gold coins. Leo brings 1 more. How many gold coins are there now?



St. Patrick's Day Math · 14

Sam has 8 shamrocks. Sam gives 4 to Ben. How many shamrocks does Sam have left?



St. Patrick's Day Math · 15

Omar has 5 green hats. Leo brings 3 more. How many green hats are there now?



St. Patrick's Day Math · 16

How many shamrocks are there?



St. Patrick's Day Math · 10

ANSWER

7

St. Patrick's Day Math · 9

ANSWER

5

St. Patrick's Day Math · 12

ANSWER

3

St. Patrick's Day Math · 11

ANSWER

9

St. Patrick's Day Math · 14

ANSWER

4

St. Patrick's Day Math · 13

ANSWER

5

St. Patrick's Day Math · 16

ANSWER

10

St. Patrick's Day Math · 15

ANSWER

8

St. Patrick's Day Math · 17

Ava has 8 green hats. Ava gives 4 to Ben. How many green hats does Ava have left?



St. Patrick's Day Math · 18

Ava has 6 gold coins. Ava gives 5 to Lily. How many gold coins does Ava have left?



St. Patrick's Day Math · 19

How many gold coins are there?



St. Patrick's Day Math · 20

Leo has 6 green hats. Lily brings 2 more. How many green hats are there now?



St. Patrick's Day Math · 21

Mia has 4 gold coins. Omar brings 3 more. How many gold coins are there now?



St. Patrick's Day Math · 22

Sam has 3 gold coins. Sam gives 1 to Mia. How many gold coins does Sam have left?



St. Patrick's Day Math · 23

Mia has 5 gold coins. Sam brings 3 more. How many gold coins are there now?



St. Patrick's Day Math · 24

Mia has 4 gold coins. Mia gives 1 to Ava. How many gold coins does Mia have left?



St. Patrick's Day Math · 18

ANSWER

1

St. Patrick's Day Math · 17

ANSWER

4

St. Patrick's Day Math · 20

ANSWER

8

St. Patrick's Day Math · 19

ANSWER

10

St. Patrick's Day Math · 22

ANSWER

2

St. Patrick's Day Math · 21

ANSWER

7

St. Patrick's Day Math · 24

ANSWER

3

St. Patrick's Day Math · 23

ANSWER

8