St. Patrick's Day Math · 1

Ella has 2 shamrocks. Sam brings 1 more. How many shamrocks are there now?



St. Patrick's Day Math · 2

Leo has 4 shamrocks. Leo gives 1 to Ben. How many shamrocks does Leo have left?



St. Patrick's Day Math · 3

Noah has 3 green hats. Ava brings 1 more. How many green hats are there now?



St. Patrick's Day Math · 4

How many gold coins are there?



St. Patrick's Day Math · 5

How many green hats are there?



St. Patrick's Day Math · 6

Leo has 1 gold coin. Ella brings 2 more. How many gold coins are there now?



St. Patrick's Day Math · 7

Leo has 5 shamrocks. Leo gives 3 to Sam. How many shamrocks does Leo have left?



St. Patrick's Day Math · 8

Omar has 2 green hats. Ben brings 1 more. How many green hats are there now?



St. Patrick's Day Math · 2

ANSWER

3

St. Patrick's Day Math · 1

ANSWER

3

St. Patrick's Day Math · 4

ANSWER

4

St. Patrick's Day Math · 3

ANSWER

4

St. Patrick's Day Math · 6

ANSWER

3

St. Patrick's Day Math · 5

ANSWER

5

St. Patrick's Day Math · 8

ANSWER

3

St. Patrick's Day Math · 7

ANSWER

2

St. Patrick's Day Math · 9

How many gold coins are there?



St. Patrick's Day Math · 10

Ben has 4 shamrocks. Lily brings 2 more. How many shamrocks are there now?



St. Patrick's Day Math · 11

Leo has 4 gold coins. Leo gives 2 to Sam. How many gold coins does Leo have left?



St. Patrick's Day Math · 12

Sam has 4 gold coins. Ella brings 2 more. How many gold coins are there now?



St. Patrick's Day Math · 13

Mia has 3 green hats. Mia gives 2 to Leo. How many green hats does Mia have left?



St. Patrick's Day Math · 14

How many shamrocks are there?



St. Patrick's Day Math · 15

Mia has 3 gold coins. Leo brings 3 more. How many gold coins are there now?



St. Patrick's Day Math · 16

Mia has 4 green hats. Mia gives 2 to Zoe. How many green hats does Mia have left?



St. Patrick's Day Math · 10

ANSWER

6

St. Patrick's Day Math · 9

ANSWER

6

St. Patrick's Day Math · 12

ANSWER

6

St. Patrick's Day Math · 11

ANSWER

2

St. Patrick's Day Math · 14

ANSWER

4

St. Patrick's Day Math · 13

ANSWER

1

St. Patrick's Day Math · 16

ANSWER

2

St. Patrick's Day Math · 15

ANSWER

6

St. Patrick's Day Math · 17

Omar has 3 shamrocks. Omar gives 2 to Leo. How many shamrocks does Omar have left?



St. Patrick's Day Math · 18

Ella has 4 gold coins. Lily brings 2 more. How many gold coins are there now?



St. Patrick's Day Math · 19

Zoe has 5 gold coins. Leo brings 1 more. How many gold coins are there now?



St. Patrick's Day Math · 20

Mia has 5 gold coins. Ben brings 2 more. How many gold coins are there now?



St. Patrick's Day Math · 21

How many gold coins are there?



St. Patrick's Day Math · 22

How many green hats are there?



St. Patrick's Day Math · 23

How many green hats are there?



St. Patrick's Day Math · 24

Zoe has 5 green hats. Zoe gives 4 to Ella. How many green hats does Zoe have left?



St. Patrick's Day Math · 18

ANSWER

6

St. Patrick's Day Math · 17

ANSWER

1

St. Patrick's Day Math · 20

ANSWER

7

St. Patrick's Day Math · 19

ANSWER

6

St. Patrick's Day Math · 22

ANSWER

6

St. Patrick's Day Math · 21

ANSWER

7

St. Patrick's Day Math · 24

ANSWER

1

St. Patrick's Day Math · 23

ANSWER

4