Sorting & Classifying Objects · 1

Which one does not belong? Write its number.



Sorting & Classifying Objects · 2

How many blue circles are there?



Sorting & Classifying Objects · 3

Sort by color. Which color has the most: red, purple, or blue?



Sorting & Classifying Objects · 4

How many more green shapes are there than red shapes?



Sorting & Classifying Objects · 5

Which one does not belong? Write its number.



Sorting & Classifying Objects · 6

How many blue stars are there?



Sorting & Classifying Objects · 7

Sort by shape. Which shape has the fewest: square, triangle, or circle?



Sorting & Classifying Objects · 8

How many more blue shapes are there than yellow shapes?



Sorting & Classifying Objects · 2

ANSWER

3

Sorting & Classifying Objects · 1

ANSWER

3

Sorting & Classifying Objects · 4

ANSWER

7

Sorting & Classifying Objects · 3

ANSWER

purple

Sorting & Classifying Objects · 6

ANSWER

1

Sorting & Classifying Objects · 5

ANSWER

4

Sorting & Classifying Objects · 8

ANSWER

3

Sorting & Classifying Objects · 7

ANSWER

circle

Sorting & Classifying Objects · 9

Which one does not belong? Write its number.



Sorting & Classifying Objects · 10

How many green circles are there?



Sorting & Classifying Objects · 11

How many more circles are there than triangles?



Sorting & Classifying Objects · 12

Sort by shape. Which shape has the most: star, circle, or heart?



Sorting & Classifying Objects · 13

Which one does not belong? Write its number.



Sorting & Classifying Objects · 14

How many red circles are there?



Sorting & Classifying Objects · 15

Sort by color. Which color has the fewest: yellow, purple, or green?



Sorting & Classifying Objects · 16

How many more blue shapes are there than yellow shapes?



Sorting & Classifying Objects · 10

ANSWER

1

Sorting & Classifying Objects · 9

ANSWER

3

Sorting & Classifying Objects · 12

ANSWER

star

Sorting & Classifying Objects · 11

ANSWER

6

Sorting & Classifying Objects · 14

ANSWER

2

Sorting & Classifying Objects · 13

ANSWER

2

Sorting & Classifying Objects · 16

ANSWER

5

Sorting & Classifying Objects · 15

ANSWER

green

Sorting & Classifying Objects · 17

Which one does not belong? Write its number.



Sorting & Classifying Objects · 18

How many green hearts are there?



Sorting & Classifying Objects · 19

Sort by shape. Which shape has the most: circle, triangle, or heart?



Sorting & Classifying Objects · 20

How many more blue shapes are there than green shapes?



Sorting & Classifying Objects · 21

Which one does not belong? Write its number.



Sorting & Classifying Objects · 22

How many yellow hearts are there?



Sorting & Classifying Objects · 23

Sort by color. Which color has the fewest: purple, green, or red?



Sorting & Classifying Objects · 24

How many more triangles are there than circles?



Sorting & Classifying Objects · 18

ANSWER

2

Sorting & Classifying Objects · 17

ANSWER

6

Sorting & Classifying Objects · 20

ANSWER

6

Sorting & Classifying Objects · 19

ANSWER

triangle

Sorting & Classifying Objects · 22

ANSWER

2

Sorting & Classifying Objects · 21

ANSWER

1

Sorting & Classifying Objects · 24

ANSWER

3

Sorting & Classifying Objects · 23

ANSWER

red