Task card 1 Picture Graphs & Tally Charts

How many gifts are in the graph?

Picture Graph: Our Favorites

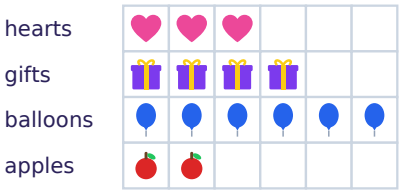

Task card 2 Picture Graphs & Tally Charts

Which has the most: trees, apples, stars, or hearts?

Picture Graph: Our Favorites

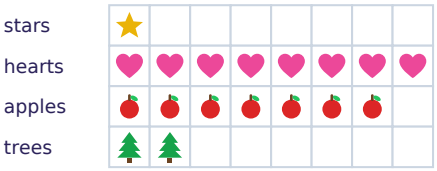

Task card 3 Picture Graphs & Tally Charts

How many more hearts than balloons are in the graph?

Picture Graph: Our Favorites



Task card 4 Picture Graphs & Tally Charts

How many votes did stars get?

Favorite	Votes
balls	1
gifts	4
stars	4
apples	6

Task card 5 Picture Graphs & Tally Charts

Which got the fewest votes: balloons, trees, apples, or stars?

Favorite	Votes
apples	6
balloons	7
stars	1
trees	4

Task card 6 Picture Graphs & Tally Charts

How many apples and gifts are in the graph in all?

Picture Graph: Our Favorites

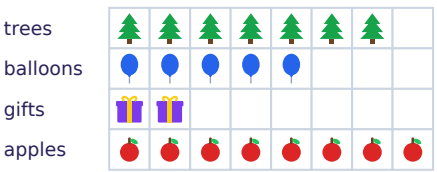

Task card 7 Picture Graphs & Tally Charts

Which got the most votes: gifts, balloons, hearts, or balls?

Favorite	Votes
hearts	4
balls	3
gifts	7
balloons	5

Task card 8 Picture Graphs & Tally Charts

How many more stars than gifts are in the graph?



Task card 9 Picture Graphs & Tally Charts

Which has the most: balloons, balls, stars, or gifts?



Task card 10 Picture Graphs & Tally Charts

How many more trees than gifts are in the graph?



Task card 11 Picture Graphs & Tally Charts

How many votes did stars get?

Favorite	Votes
apples	3
stars	1
balls	6
trees	2

Task card 12 Picture Graphs & Tally Charts

How many hearts and stars are in the graph in all?



Task card 13 Picture Graphs & Tally Charts

Which got the fewest votes: trees, hearts, balls, or apples?

Favorite	Votes
apples	7
hearts	5
balls	1
trees	2

Task card 14 Picture Graphs & Tally Charts

How many more votes did hearts get than balloons?

Favorite	Votes
trees	8
hearts	9
balls	2
balloons	3

Task card 15 Picture Graphs & Tally Charts

Which has the fewest: stars, trees, gifts, or apples?

Picture Graph: Our Favorites

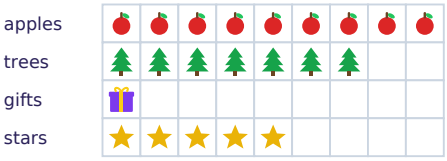

Task card 16 Picture Graphs & Tally Charts

How many votes did trees and apples get in all?

Favorite	Votes
trees	3
stars	8
apples	1
balloons	2

Task card 17 Picture Graphs & Tally Charts

How many more balls than apples are in the graph?

Picture Graph: Our Favorites

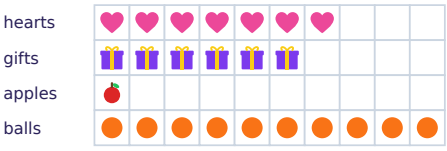

Task card 18 Picture Graphs & Tally Charts

How many votes did trees get?

Favorite	Votes
trees	8
balloons	6
hearts	4
stars	5

Task card 19 Picture Graphs & Tally Charts

How many apples and trees are in the graph in all?



Task card 20 Picture Graphs & Tally Charts

Which got the most votes: balloons, trees, stars, or gifts?

Favorite	Votes
gifts	𝍸 ||||
trees	𝍸
balloons	𝍸 ||
stars	𝍸 |||

Task card 21 Picture Graphs & Tally Charts

How many fewer stars than balls are in the graph?



Task card 22 Picture Graphs & Tally Charts

How many more votes did stars get than trees?

Favorite	Votes
trees	||||
gifts	|||
balls	𝍸 |
stars	𝍸

Task card 23 Picture Graphs & Tally Charts

How many votes did apples and hearts get in all?

Favorite	Votes
trees	𝍸 ||||
hearts	||||
balls	𝍸 |||
apples	𝍸

Task card 24 Picture Graphs & Tally Charts

How many fewer votes did apples get than stars?

Favorite	Votes
balloons	|
stars	𝍸 𝍸
apples	||
hearts	𝍸

Picture Graphs & Tally Charts Task Cards

Recording sheet · Kindergarten · Read the graph or the tally chart. Write a number, or a word from the question.

Scan to check your answers

Name: _____ Date: _____

1	2	3	4
5	6	7	8
9	10	11	12
13	14	15	16
17	18	19	20
21	22	23	24

Picture Graphs & Tally Charts Task Cards: Answer Key

Kindergarten · Medium

The answers online

1. 4	**2.** hearts	**3.** 3
4. 5	**5.** stars	**6.** 10
7. gifts	**8.** 1	**9.** stars
10. 3	**11.** 1	**12.** 9
13. balls	**14.** 6	**15.** gifts
16. 4	**17.** 9	**18.** 8
19. 6	**20.** gifts	**21.** 2
22. 1	**23.** 9	**24.** 8