Task card 1 Picture Graphs & Tally Charts

How many votes did apples get?

Favorite	Votes
balls	8
balloons	2
apples	11
hearts	10

Task card 2 Picture Graphs & Tally Charts

How many more balls than apples are in the graph?

Picture Graph: Our Favorites

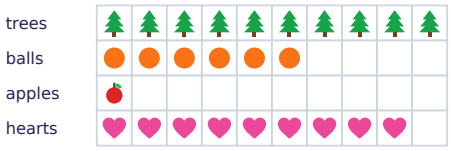

Task card 3 Picture Graphs & Tally Charts

How many votes did balloons and hearts get in all?

Favorite	Votes
apples	3
balloons	9
balls	4
hearts	8

Task card 4 Picture Graphs & Tally Charts

How many fewer gifts than apples are in the graph?

Picture Graph: Our Favorites



Task card 5 Picture Graphs & Tally Charts

How many more votes did gifts get than trees?

Favorite	Votes
trees	3
gifts	5
balloons	7
stars	10

Task card 6 Picture Graphs & Tally Charts

How many stars and balls are in the graph in all?

Picture Graph: Our Favorites



Task card 7 Picture Graphs & Tally Charts

Which got the fewest votes: gifts, hearts, trees, or stars?

Favorite	Votes
gifts	2
stars	12
hearts	12
trees	8

Task card 8 Picture Graphs & Tally Charts

How many fewer votes did balloons get than stars?

Favorite	Votes
balloons	3
hearts	11
balls	6
stars	4

Task card 9 Picture Graphs & Tally Charts

How many more votes did gifts get than balls?

Favorite	Votes
apples	2
gifts	11
stars	8
balls	5

Task card 10 Picture Graphs & Tally Charts

How many votes did apples and gifts get in all?

Favorite	Votes
trees	8
apples	11
hearts	5
gifts	6

Task card 11 Picture Graphs & Tally Charts

How many fewer balloons than gifts are in the graph?

Picture Graph: Our Favorites

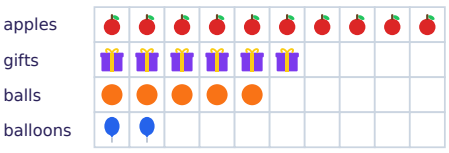

Task card 12 Picture Graphs & Tally Charts

How many votes did stars get?

Favorite	Votes
gifts	15
trees	4
stars	13
balloons	12

Task card 13 Picture Graphs & Tally Charts

How many hearts and apples are in the graph in all?

Picture Graph: Our Favorites



Task card 14 Picture Graphs & Tally Charts

How many fewer votes did hearts get than balls?

Favorite	Votes
apples	2
stars	6
balls	11
hearts	3

Task card 15 Picture Graphs & Tally Charts

Which got the most votes: apples, trees, gifts, or balloons?

Favorite	Votes
trees	11
balloons	14
gifts	7
apples	10

Task card 16 Picture Graphs & Tally Charts

How many more balls than apples are in the graph?

Picture Graph: Our Favorites

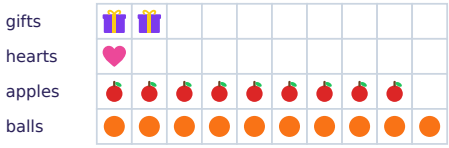

Task card 17 Picture Graphs & Tally Charts

How many votes did gifts get?

Favorite	Votes
gifts	6
stars	11
balls	9
balloons	8

Task card 18 Picture Graphs & Tally Charts

How many more balls than balloons are in the graph?

Picture Graph: Our Favorites



Task card 19 Picture Graphs & Tally Charts

How many votes did apples and balls get in all?

Favorite	Votes
apples	7
gifts	4
balls	1
hearts	6

Task card 20 Picture Graphs & Tally Charts

How many fewer stars than gifts are in the graph?

Picture Graph: Our Favorites



Task card 21 Picture Graphs & Tally Charts

How many more votes did stars get than gifts?

Favorite	Votes
gifts	2
stars	8
balls	4
balloons	4

Task card 22 Picture Graphs & Tally Charts

How many balls and hearts are in the graph in all?

Picture Graph: Our Favorites



Task card 23 Picture Graphs & Tally Charts

Which got the fewest votes: gifts, balls, stars, or apples?

Favorite	Votes
gifts	11
stars	10
apples	3
balls	5

Task card 24 Picture Graphs & Tally Charts

How many fewer votes did apples get than balls?

Favorite	Votes
apples	9
stars	2
balls	12
trees	5

Picture Graphs & Tally Charts Task Cards

Recording sheet · Kindergarten · Read the graph or the tally chart. Write a number, or a word from the question.

Name: _____ Date: _____

Scan to check your answers

1	2	3	4
5	6	7	8
9	10	11	12
13	14	15	16
17	18	19	20
21	22	23	24

Picture Graphs & Tally Charts Task Cards: Answer Key

Kindergarten · Hard

The answers online

1. 11	**2.** 5	**3.** 17
4. 3	**5.** 2	**6.** 16
7. gifts	**8.** 1	**9.** 6
10. 17	**11.** 4	**12.** 13
13. 13	**14.** 8	**15.** balloons
16. 1	**17.** 6	**18.** 2
19. 13	**20.** 3	**21.** 8
22. 10	**23.** apples	**24.** 3