Task card 1 Picture Graphs & Tally Charts

How many balls are in the graph?

Picture Graph: Our Favorites

balls
gifts
trees

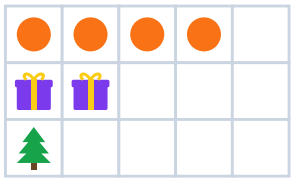

Task card 2 Picture Graphs & Tally Charts

Which has the most: apples, trees, or stars?

Picture Graph: Our Favorites

stars
trees
apples

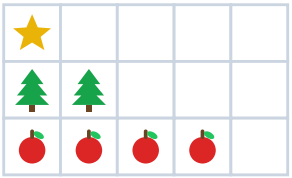

Task card 3 Picture Graphs & Tally Charts

How many apples are in the graph?

Picture Graph: Our Favorites

gifts
stars
apples



Task card 4 Picture Graphs & Tally Charts

Which has the fewest: gifts, trees, or balls?

Picture Graph: Our Favorites

trees
gifts
balls

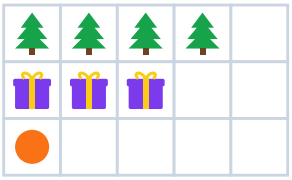

Task card 5 Picture Graphs & Tally Charts

How many balls are in the graph?

Picture Graph: Our Favorites

balls
balloons
hearts



Task card 6 Picture Graphs & Tally Charts

Which has the most: balls, hearts, or apples?

Picture Graph: Our Favorites

apples
hearts
balls



Task card 7 Picture Graphs & Tally Charts

How many apples are in the graph?

Picture Graph: Our Favorites

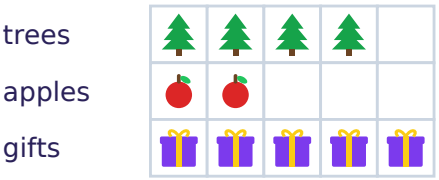

Task card 8 Picture Graphs & Tally Charts

Which has the fewest: apples, hearts, or balloons?

Picture Graph: Our Favorites

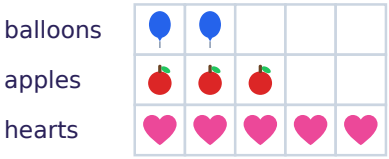

Task card 9 Picture Graphs & Tally Charts

How many balloons are in the graph?

Picture Graph: Our Favorites

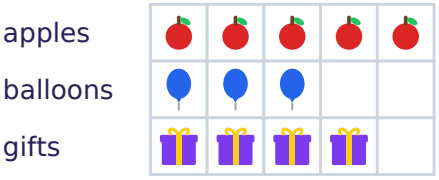

Task card 10 Picture Graphs & Tally Charts

Which has the most: trees, apples, or hearts?

Picture Graph: Our Favorites



Task card 11 Picture Graphs & Tally Charts

How many more balloons than trees are in the graph?

Picture Graph: Our Favorites

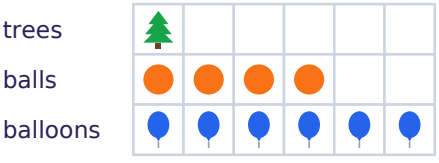

Task card 12 Picture Graphs & Tally Charts

Which has the fewest: gifts, stars, or balls?

Picture Graph: Our Favorites



Task card 13 Picture Graphs & Tally Charts

How many balls are in the graph?

Picture Graph: Our Favorites

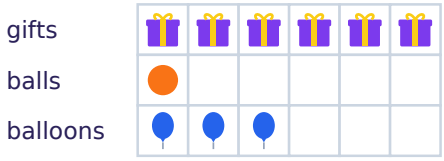

Task card 14 Picture Graphs & Tally Charts

How many more gifts than balls are in the graph?

Picture Graph: Our Favorites



Task card 15 Picture Graphs & Tally Charts

Which has the most: apples, trees, or balloons?

Picture Graph: Our Favorites

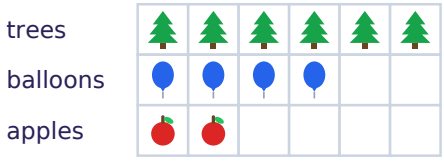

Task card 16 Picture Graphs & Tally Charts

Which has the fewest: balls, balloons, or stars?

Picture Graph: Our Favorites



Task card 17 Picture Graphs & Tally Charts

How many trees are in the graph?

Picture Graph: Our Favorites

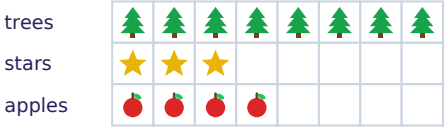

Task card 18 Picture Graphs & Tally Charts

Which has the most: hearts, gifts, or apples?

Picture Graph: Our Favorites



Task card 19 Picture Graphs & Tally Charts

How many more trees than gifts are in the graph?

Picture Graph: Our Favorites

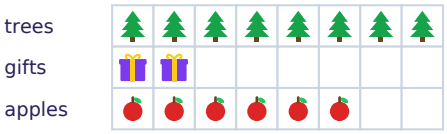

Task card 20 Picture Graphs & Tally Charts

Which has the fewest: stars, gifts, or balls?

Picture Graph: Our Favorites



Task card 21 Picture Graphs & Tally Charts

How many trees and hearts are in the graph in all?

Picture Graph: Our Favorites

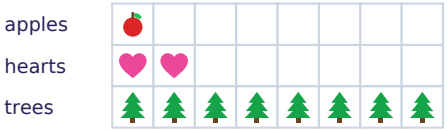

Task card 22 Picture Graphs & Tally Charts

How many more trees than balls are in the graph?

Picture Graph: Our Favorites

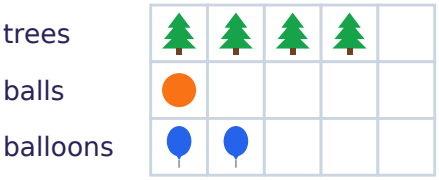

Task card 23 Picture Graphs & Tally Charts

How many votes did trees get?

Favorite	Votes
stars	|||
hearts	𝍸 |
trees	||

Task card 24 Picture Graphs & Tally Charts

Which got the most votes: gifts, apples, or hearts?

Favorite	Votes
apples	𝍸
gifts	|||
hearts	||| |

Picture Graphs & Tally Charts Task Cards

Recording sheet · Kindergarten · Read the graph or the tally chart. Write a number, or a word from the question.

Name: _____ Date: _____

Scan to check your answers

1	2	3	4
5	6	7	8
9	10	11	12
13	14	15	16
17	18	19	20
21	22	23	24

Picture Graphs & Tally Charts Task Cards: Answer Key

Kindergarten · Easy

The answers online

1. 4	**2.** apples	**3.** 5
4. balls	**5.** 4	**6.** hearts
7. 2	**8.** balloons	**9.** 3
10. hearts	**11.** 5	**12.** balls
13. 1	**14.** 2	**15.** trees
16. balloons	**17.** 8	**18.** gifts
19. 6	**20.** gifts	**21.** 10
22. 3	**23.** 2	**24.** apples