How many gifts are in the graph?

Picture Graph: Our Favorites

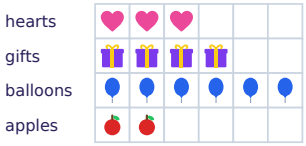

Which has the most: trees, apples, stars, or hearts?

Picture Graph: Our Favorites

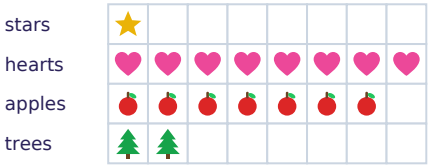

How many more hearts than balloons are in the graph?

Picture Graph: Our Favorites



How many votes did stars get?

Favorite	Votes
balls	|
gifts	~~||||~~ |||
stars	~~||||~~
apples	~~||||~~ ||

Which got the fewest votes: balloons, trees, apples, or stars?

Favorite	Votes
apples	~~||||~~ |
balloons	~~||||~~ ||
stars	|
trees	~~||||~~

How many apples and gifts are in the graph in all?

Picture Graph: Our Favorites

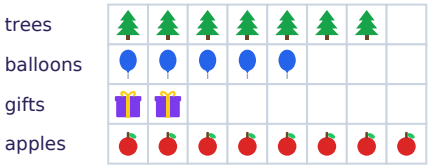

Which got the most votes: gifts, balloons, hearts, or balls?

Favorite	Votes
hearts	||||
balls	|||
gifts	~~||||~~ ||
balloons	~~||||~~

How many more stars than gifts are in the graph?

Picture Graph: Our Favorites



Picture Graphs & Tally Charts · 2

ANSWER

hearts

Picture Graphs & Tally Charts · 1

ANSWER

4

Picture Graphs & Tally Charts · 4

ANSWER

5

Picture Graphs & Tally Charts · 3

ANSWER

3

Picture Graphs & Tally Charts · 6

ANSWER

10

Picture Graphs & Tally Charts · 5

ANSWER

stars

Picture Graphs & Tally Charts · 8

ANSWER

1

Picture Graphs & Tally Charts · 7

ANSWER

gifts

Which has the most: balloons, balls, stars, or gifts?

Picture Graph: Our Favorites

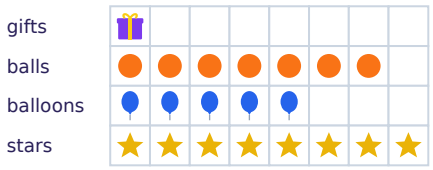

How many more trees than gifts are in the graph?

Picture Graph: Our Favorites



How many votes did stars get?

Favorite	Votes
apples	3
stars	1
balls	5
trees	2

How many hearts and stars are in the graph in all?

Picture Graph: Our Favorites



Which got the fewest votes: trees, hearts, balls, or apples?

Favorite	Votes
apples	7
hearts	5
balls	1
trees	2

How many more votes did hearts get than balloons?

Favorite	Votes
trees	8
hearts	9
balls	2
balloons	3

Which has the fewest: stars, trees, gifts, or apples?

Picture Graph: Our Favorites

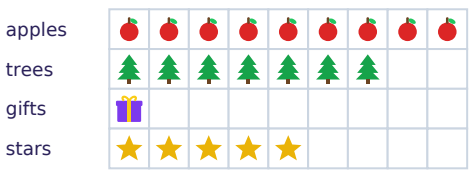

How many votes did trees and apples get in all?

Favorite	Votes
trees	3
stars	7
apples	1
balloons	2

Picture Graphs & Tally Charts · 10

ANSWER

3

Picture Graphs & Tally Charts · 9

ANSWER

stars

Picture Graphs & Tally Charts · 12

ANSWER

9

Picture Graphs & Tally Charts · 11

ANSWER

1

Picture Graphs & Tally Charts · 14

ANSWER

6

Picture Graphs & Tally Charts · 13

ANSWER

balls

Picture Graphs & Tally Charts · 16

ANSWER

4

Picture Graphs & Tally Charts · 15

ANSWER

gifts

How many more balls than apples are in the graph?

Picture Graph: Our Favorites

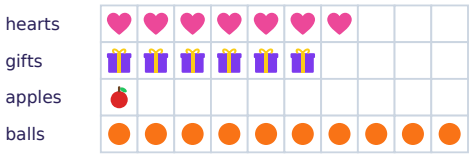

How many votes did trees get?

Favorite	Votes
trees	8
balloons	7
hearts	4
stars	6

How many apples and trees are in the graph in all?

Picture Graph: Our Favorites

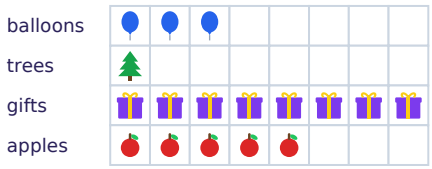

Which got the most votes: balloons, trees, stars, or gifts?

Favorite	Votes
gifts	9
trees	5
balloons	7
stars	8

How many fewer stars than balls are in the graph?

Picture Graph: Our Favorites

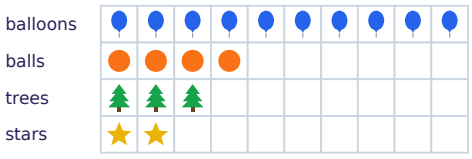

How many more votes did stars get than trees?

Favorite	Votes
trees	4
gifts	3
balls	6
stars	5

How many votes did apples and hearts get in all?

Favorite	Votes
trees	9
hearts	4
balls	8
apples	5

How many fewer votes did apples get than stars?

Favorite	Votes
balloons	1
stars	10
apples	2
hearts	5

Picture Graphs & Tally Charts · 18

ANSWER

8

Picture Graphs & Tally Charts · 17

ANSWER

9

Picture Graphs & Tally Charts · 20

ANSWER

gifts

Picture Graphs & Tally Charts · 19

ANSWER

6

Picture Graphs & Tally Charts · 22

ANSWER

1

Picture Graphs & Tally Charts · 21

ANSWER

2

Picture Graphs & Tally Charts · 24

ANSWER

8

Picture Graphs & Tally Charts · 23

ANSWER

9